Giải thích X và Y theo tỷ lệ

Họ và Tên:

Xác định giá trị của A có nghĩa là gì trong mỗi bài toán.

1)

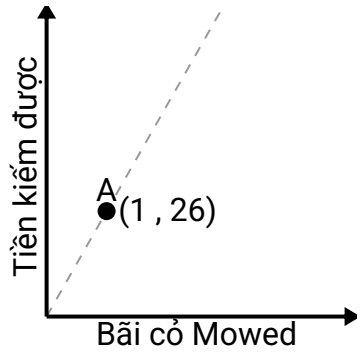

2)

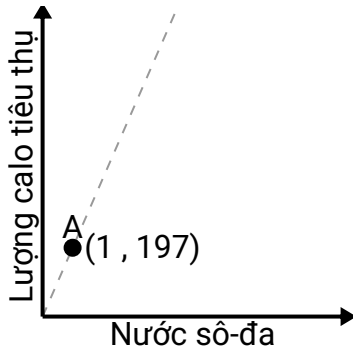

3)

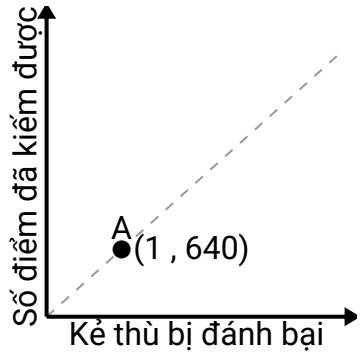

4)

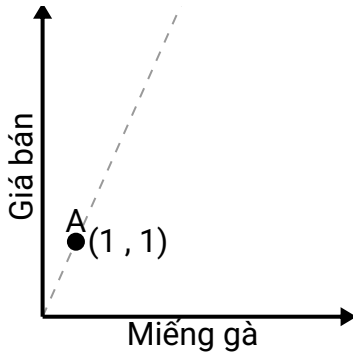

5)

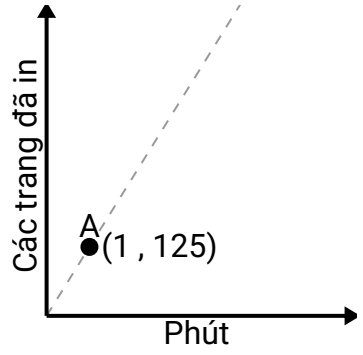

6)

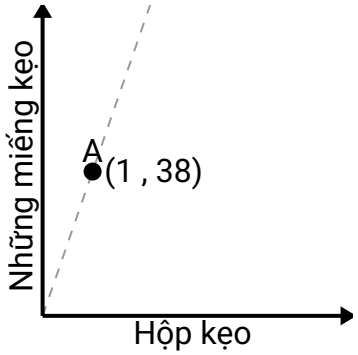

Xác định giá trị của A có nghĩa là gì trong mỗi bài toán.

1)

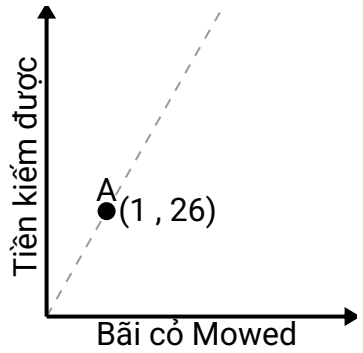

Đối với mỗi bãi cỏ được cắt, $ 26 được kiếm.

2)

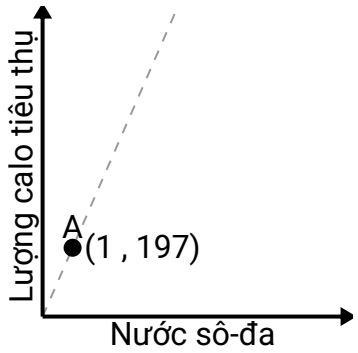

Đối với mỗi lon nước ngọt đã uống, 197 calo được tiêu thụ.

3)

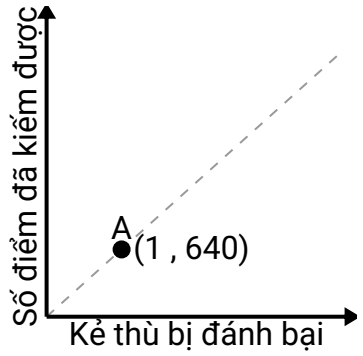

Đối với mỗi kẻ thù bị đánh bại, 640 sẽ kiếm được điểm.

4)

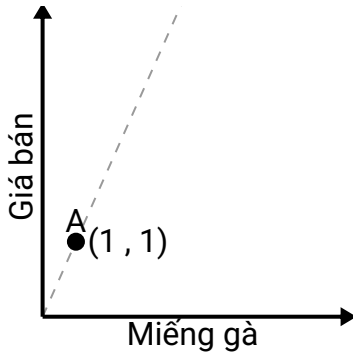

Mỗi miếng gà có giá $ 1.

5)

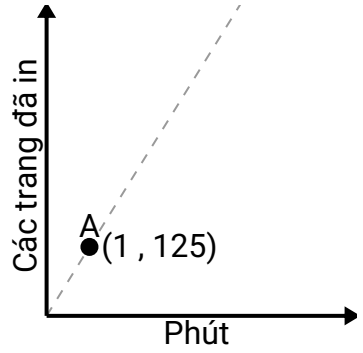

Mỗi phút 125 trang được in.

6)

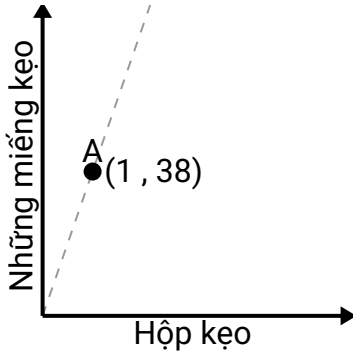

Mỗi hộp kẹo có 38 viên kẹo.