Hàm số (cộng & trừ) Họ và Tên:

Xác định quy tắc của hàm số.

Vd)

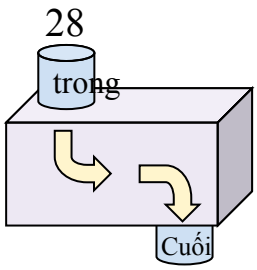

Thêm 10

1)

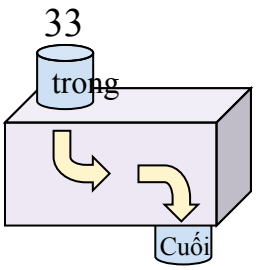

2)

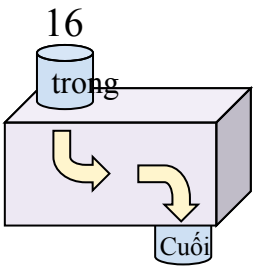

3)

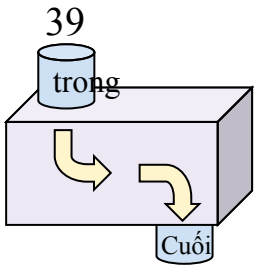

4)

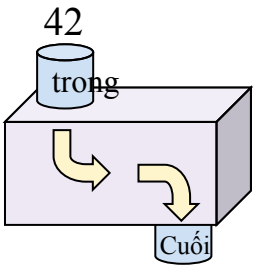

5)

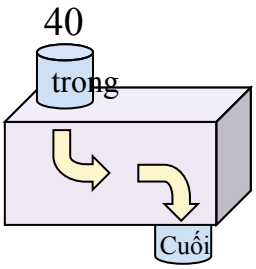

6)

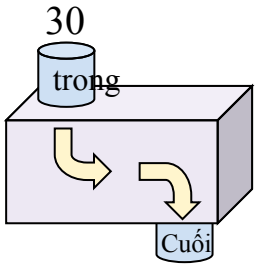

7)

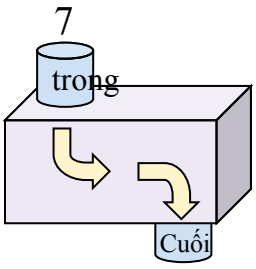

8)

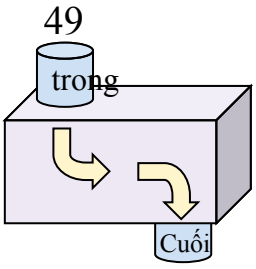

9)

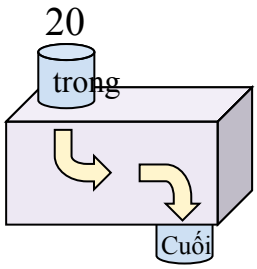

10)

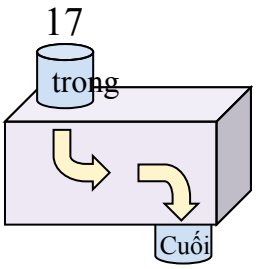

11)

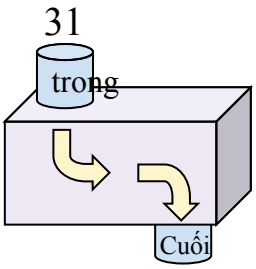

Câu trả lời

Vd. **Thêm 10**

1. _____
2. _____
3. _____
4. _____
5. _____
6. _____
7. _____
8. _____
9. _____
10. _____
11. _____

Hàm số (cộng & trừ)

Họ và Tên: **Lời giải**

Xác định quy tắc của hàm số.

Vd)

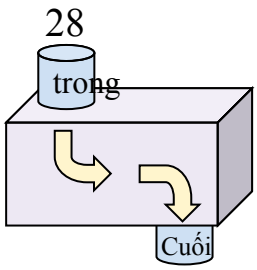

Thêm 10

1)

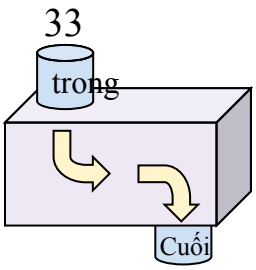

Trừ 21

2)

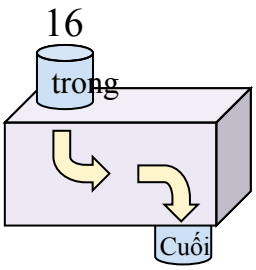

Thêm 5

3)

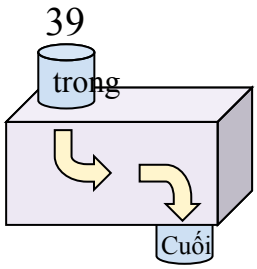

Trừ 24

4)

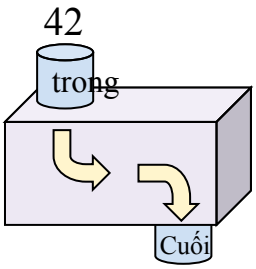

Trừ 22

5)

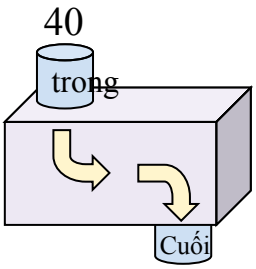

Trừ 10

6)

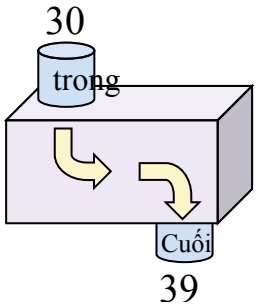

Thêm 9

7)

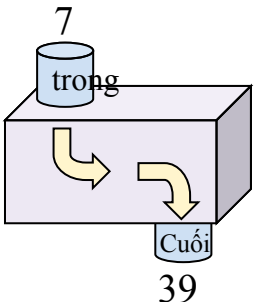

Thêm 32

8)

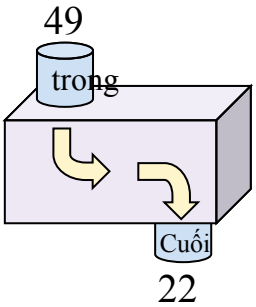

Trừ 27

9)

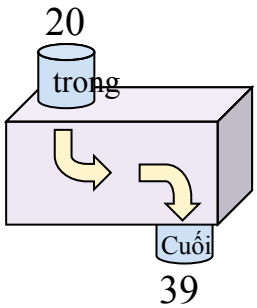

Thêm 19

10)

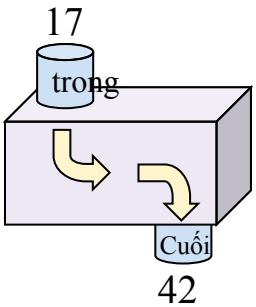

Thêm 25

11)

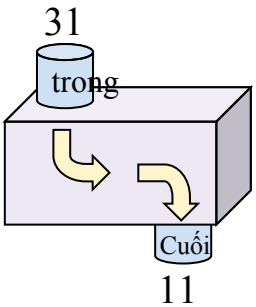

Trừ 20

Câu trả lời

Vd. **Thêm 10**

1. **Trừ 21**
2. **Thêm 5**
3. **Trừ 24**
4. **Trừ 22**
5. **Trừ 10**
6. **Thêm 9**
7. **Thêm 32**
8. **Trừ 27**
9. **Thêm 19**
10. **Thêm 25**
11. **Trừ 20**