Xác định quy tắc của hàm số.

Vd)

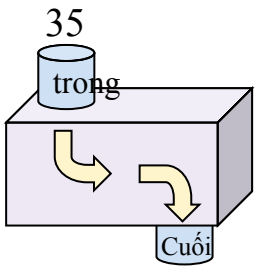

Trừ 13

1)

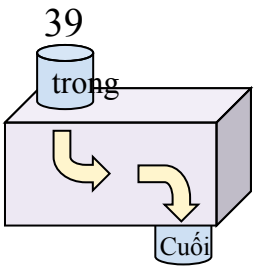

2)

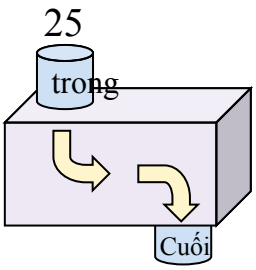

3)

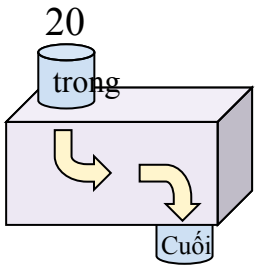

4)

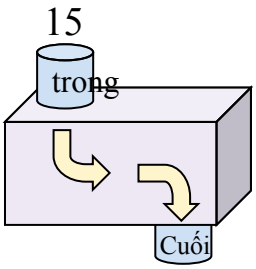

5)

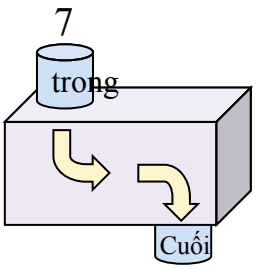

6)

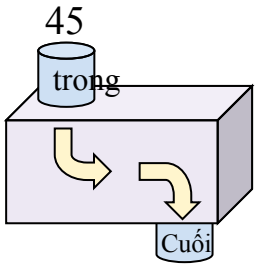

7)

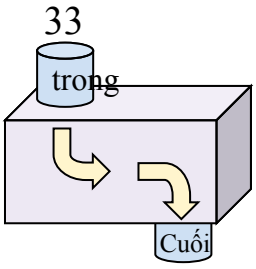

8)

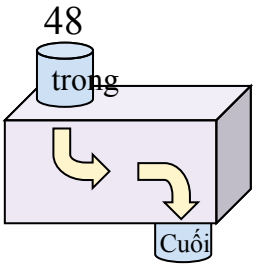

9)

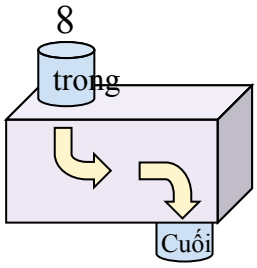

10)

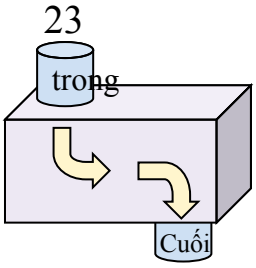

11)

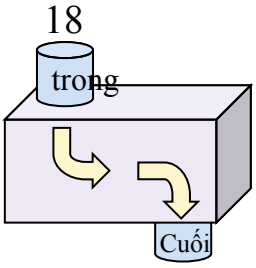

Câu trả lời

Vd. Trừ 13

1. _____
2. _____
3. _____
4. _____
5. _____
6. _____
7. _____
8. _____
9. _____
10. _____
11. _____

1-10	91	82	73	64	55	45	36	27	18	9
11	0									

Xác định quy tắc của hàm số.

Vd)

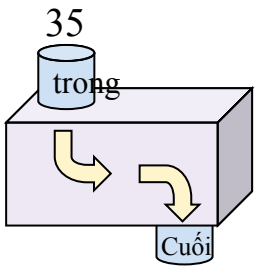

Trừ 13

1)

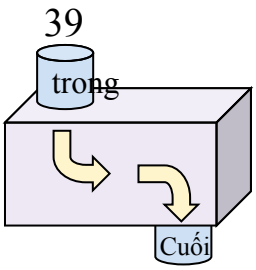

Trừ 31

2)

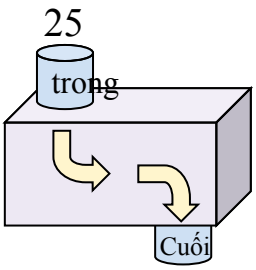

Thêm 10

3)

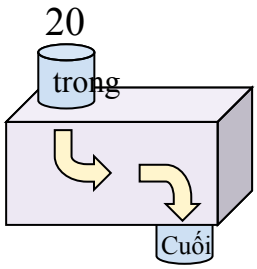

Thêm 8

4)

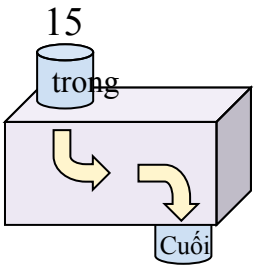

Thêm 34

5)

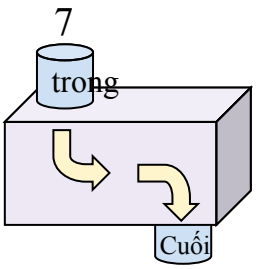

Thêm 21

6)

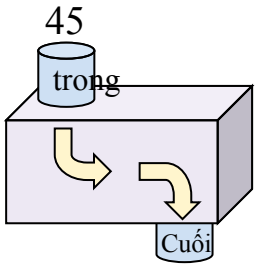

Trừ 21

7)

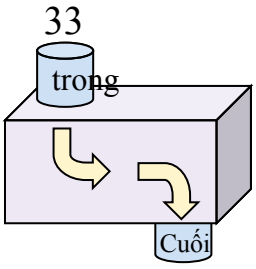

Trừ 13

8)

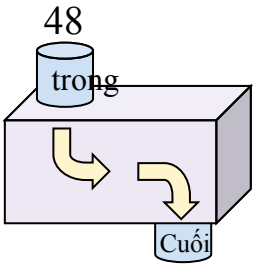

Trừ 28

9)

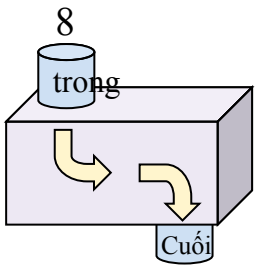

Thêm 38

10)

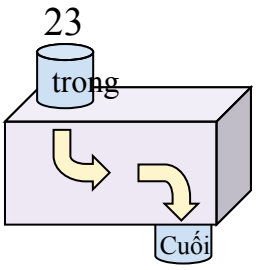

Thêm 12

11)

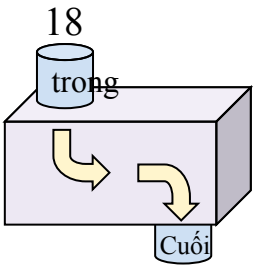

Thêm 6

Câu trả lời

Vd.	Trừ 13
1.	Trừ 31
2.	Thêm 10
3.	Thêm 8
4.	Thêm 34
5.	Thêm 21
6.	Trừ 21
7.	Trừ 13
8.	Trừ 28
9.	Thêm 38
10.	Thêm 12
11.	Thêm 6

1-10	91	82	73	64	55	45	36	27	18	9
11	0									