Xác định quy tắc của hàm số.

Vd)

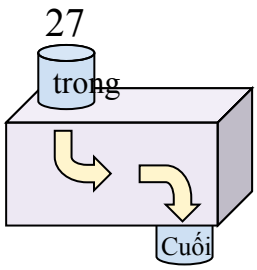

Trừ 5

1)

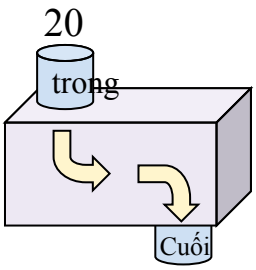

2)

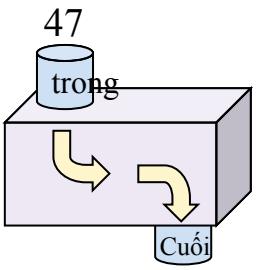

3)

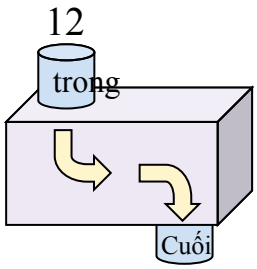

4)

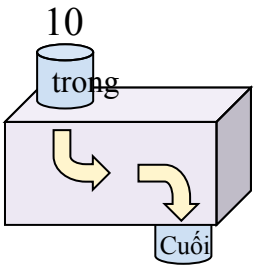

5)

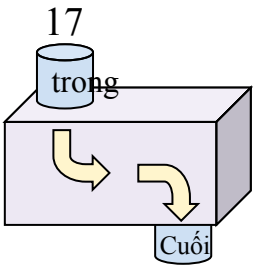

6)

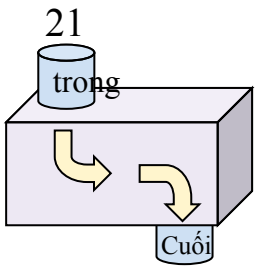

7)

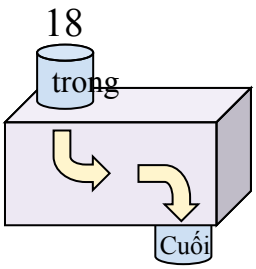

8)

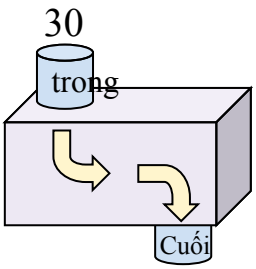

9)

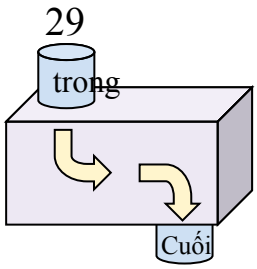

10)

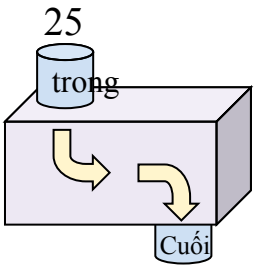

11)

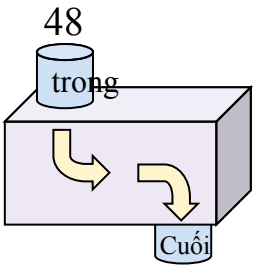

Câu trả lời

Vd. Trừ 5

1. _____
2. _____
3. _____
4. _____
5. _____
6. _____
7. _____
8. _____
9. _____
10. _____
11. _____

1-10	91	82	73	64	55	45	36	27	18	9
11	0									

Xác định quy tắc của hàm số.

Vd)

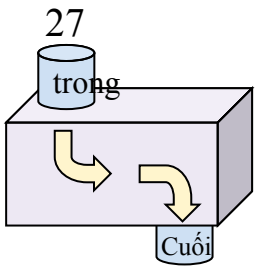

Trừ 5

1)

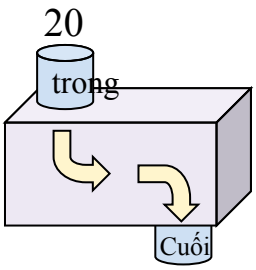

Thêm 14

2)

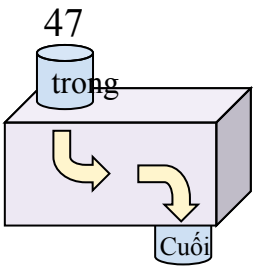

Trừ 33

3)

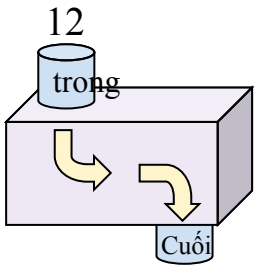

Thêm 27

4)

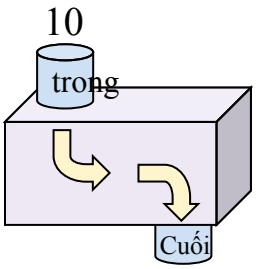

Thêm 30

5)

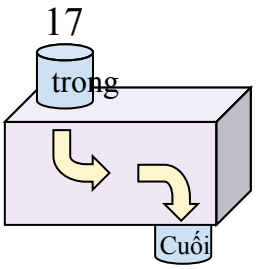

Thêm 25

6)

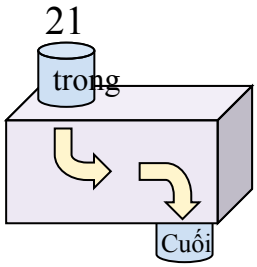

Thêm 24

7)

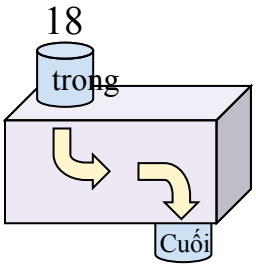

Trừ 12

8)

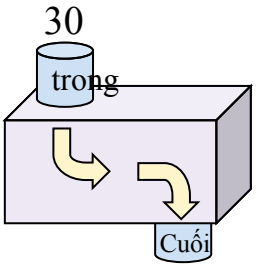

Trừ 6

9)

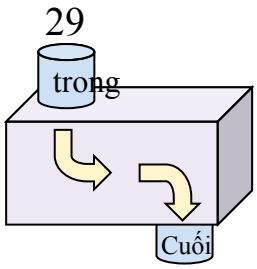

Thêm 18

10)

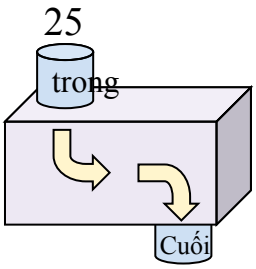

Thêm 5

11)

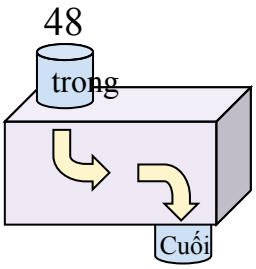

Trừ 31

Câu trả lời

Vd.	Trừ 5
1.	Thêm 14
2.	Trừ 33
3.	Thêm 27
4.	Thêm 30
5.	Thêm 25
6.	Thêm 24
7.	Trừ 12
8.	Trừ 6
9.	Thêm 18
10.	Thêm 5
11.	Trừ 31

1-10	91	82	73	64	55	45	36	27	18	9
11	0									