Phép nhân với trục số

Họ và Tên:

Dùng trục số để giải bài tính.

1) $2 \times 9 =$

$9 \times 2 =$

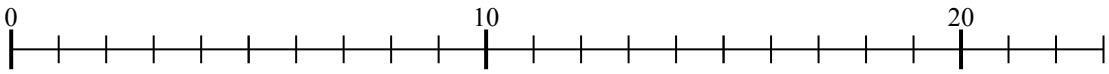

2) $2 \times 7 =$

$7 \times 2 =$

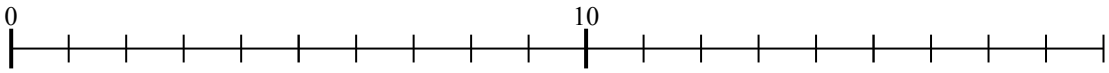

3) $2 \times 8 =$

$8 \times 2 =$

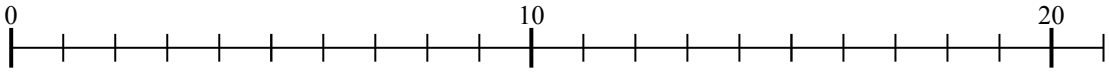

4) $4 \times 2 =$

$2 \times 4 =$

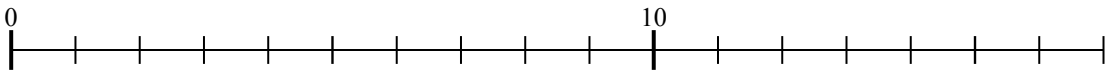

5) $3 \times 4 =$

$4 \times 3 =$

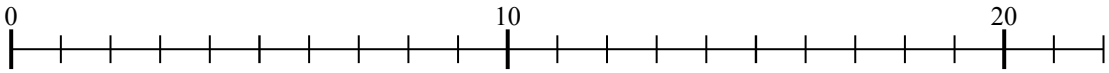

6) $5 \times 3 =$

$3 \times 5 =$

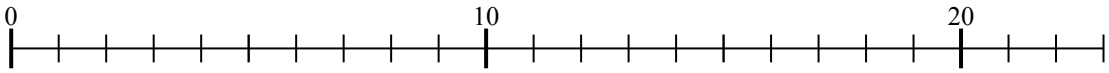

7) $4 \times 6 =$

$6 \times 4 =$

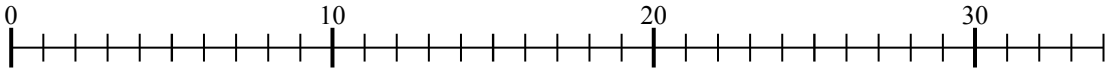

8) $2 \times 6 =$

$6 \times 2 =$

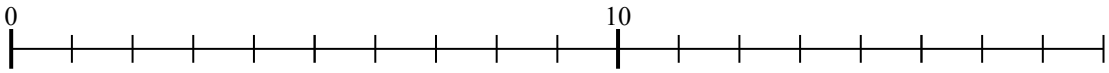

9) $3 \times 2 =$

$2 \times 3 =$

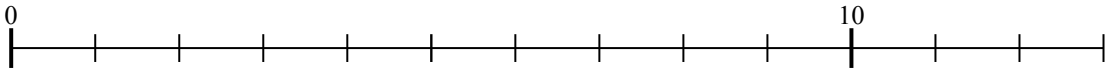

10) $3 \times 9 =$

$9 \times 3 =$

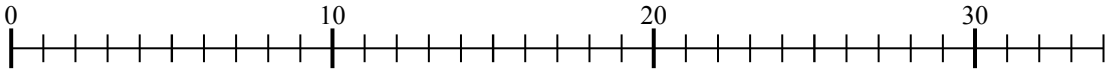

11) $5 \times 8 =$

$8 \times 5 =$

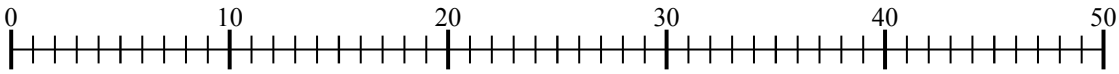

Câu trả lời

1. _____
2. _____
3. _____
4. _____
5. _____
6. _____
7. _____
8. _____
9. _____
10. _____
11. _____

Phép nhân với trục số

Họ và Tên: **Lời giải**

Dùng trục số để giải bài tính.

1) $2 \times 9 =$

$9 \times 2 =$

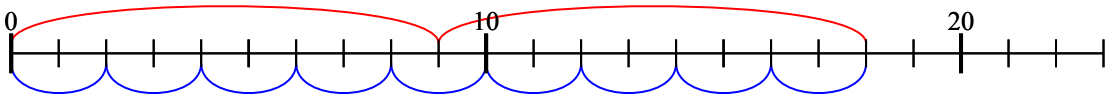

2) $2 \times 7 =$

$7 \times 2 =$

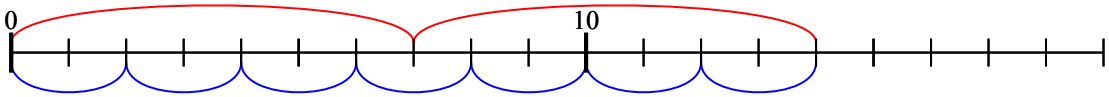

3) $2 \times 8 =$

$8 \times 2 =$

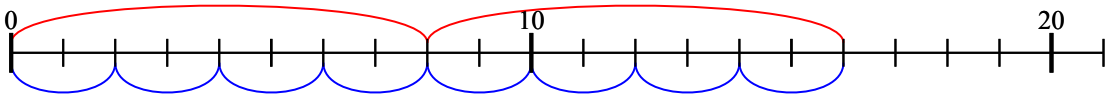

4) $4 \times 2 =$

$2 \times 4 =$

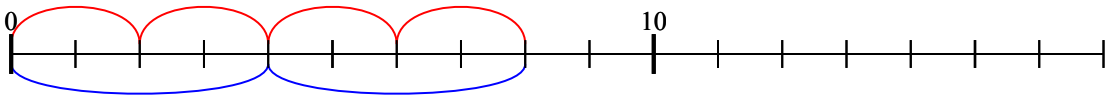

5) $3 \times 4 =$

$4 \times 3 =$

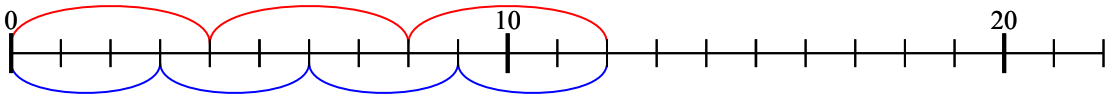

6) $5 \times 3 =$

$3 \times 5 =$

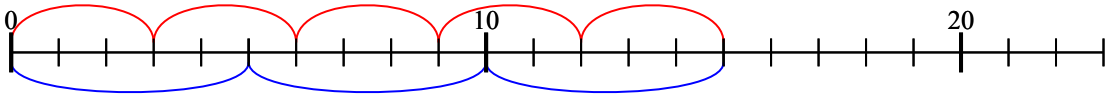

7) $4 \times 6 =$

$6 \times 4 =$

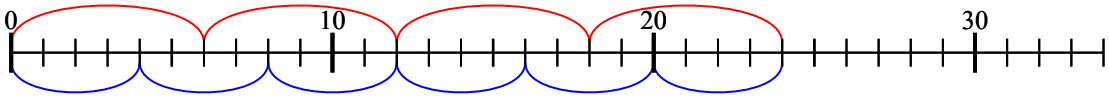

8) $2 \times 6 =$

$6 \times 2 =$

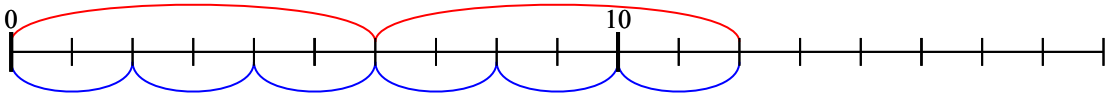

9) $3 \times 2 =$

$2 \times 3 =$

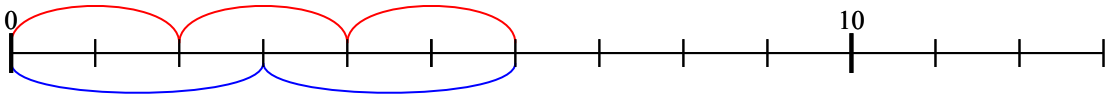

10) $3 \times 9 =$

$9 \times 3 =$

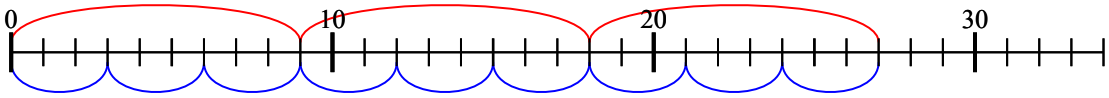

11) $5 \times 8 =$

$8 \times 5 =$

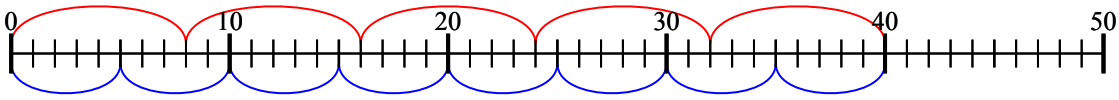

Câu trả lời

1. **18**
2. **14**
3. **16**
4. **8**
5. **12**
6. **15**
7. **24**
8. **12**
9. **6**
10. **27**
11. **40**