Tìm khoảng cách trên một trục tọa độ

Họ và Tên:

**Tìm khoảng cách giữa hai điểm. Làm tròn câu trả lời đến hàng phần chục.**

**Vd)**

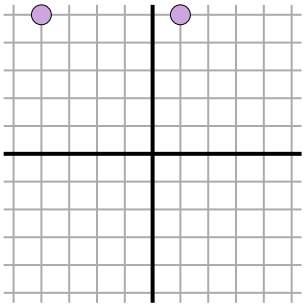

**1)**

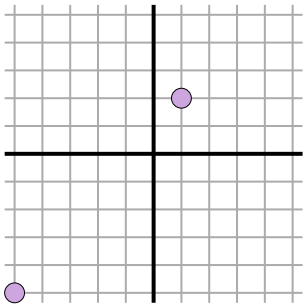

**2)**

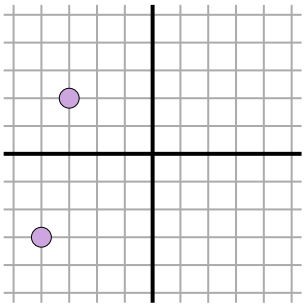

**3)**

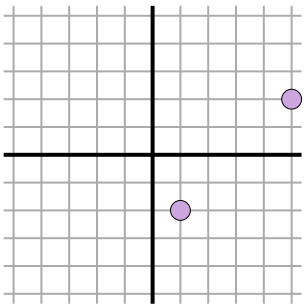

**4)**

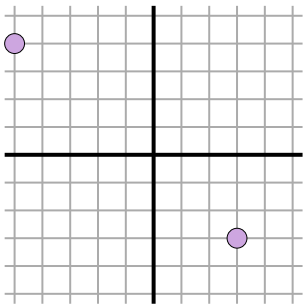

**5)**

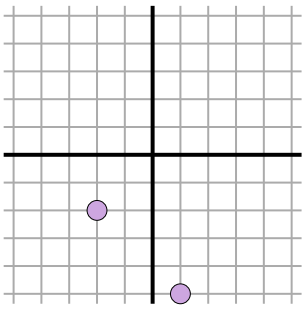

**6)**

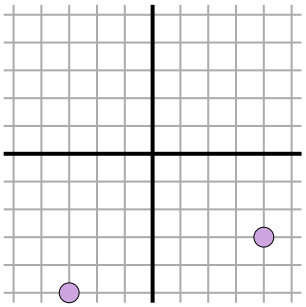

**7)**

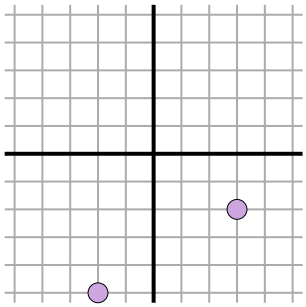

**8)**

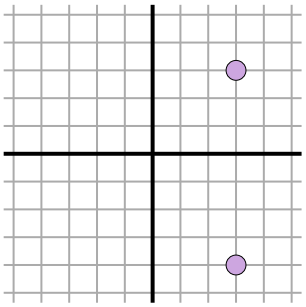

**9)**

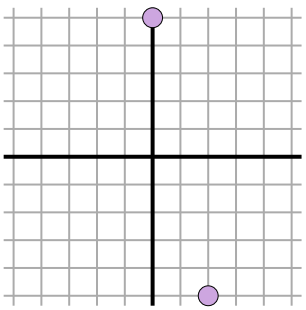

**10)**

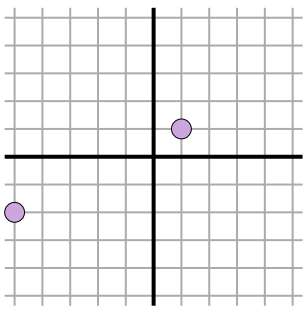

**11)**

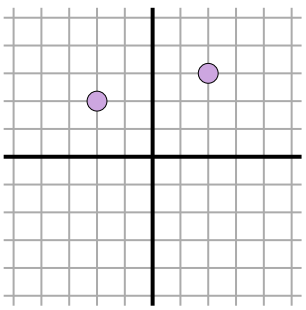

**Câu trả lời**

Vd. 5

1. _____

2. _____

3. _____

4. _____

5. _____

6. _____

7. _____

8. _____

9. _____

10. _____

11. _____



| | | | | | | | | | | |
|---|---|---|---|---|---|---|---|---|---|---|
| 1-10 | 91 | 82 | 73 | 64 | 55 | 45 | 36 | 27 | 18 | 9 |
| 11 | 0 | | | | | | | | | |

Tìm khoảng cách trên một trục tọa độ

Họ và Tên: **Lời giải**

**Tìm khoảng cách giữa hai điểm. Làm tròn câu trả lời đến hàng phần chục.**

**Vd)**

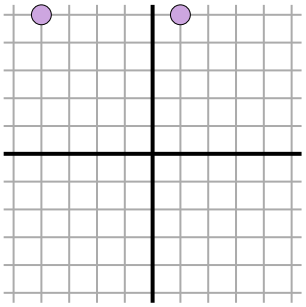

$\sqrt{(-4-1)^2 + (5-5)^2}$

$\sqrt{(25) + (0)}$

**1)**

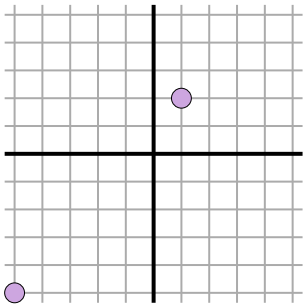

$\sqrt{(-5-1)^2 + (-5-2)^2}$

$\sqrt{(36) + (49)}$

**2)**

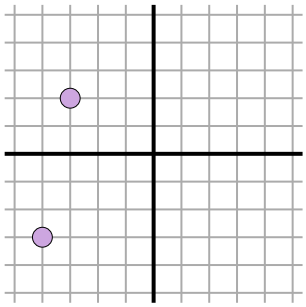

$\sqrt{(-4--3)^2 + (-3-2)^2}$

$\sqrt{(1) + (25)}$

**3)**

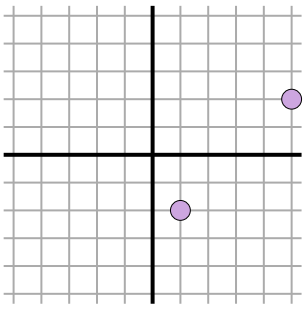

$\sqrt{(1-5)^2 + (-2-2)^2}$

$\sqrt{(16) + (16)}$

**4)**

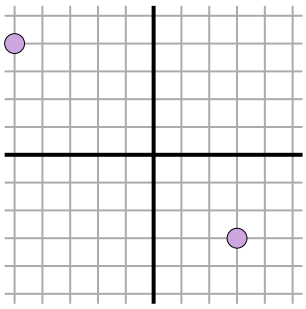

$\sqrt{(-5-3)^2 + (4--3)^2}$

$\sqrt{(64) + (49)}$

**5)**

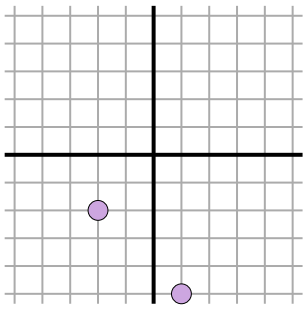

$\sqrt{(-2-1)^2 + (-2--5)^2}$

$\sqrt{(9) + (9)}$

**6)**

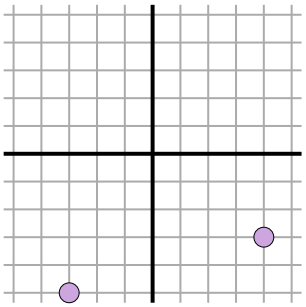

$\sqrt{(-3-4)^2 + (-5--3)^2}$

$\sqrt{(49) + (4)}$

**7)**

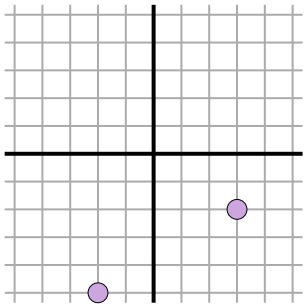

$\sqrt{(3--2)^2 + (-2--5)^2}$

$\sqrt{(25) + (9)}$

**8)**

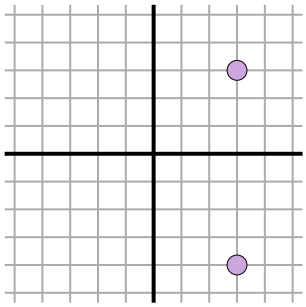

$\sqrt{(3-3)^2 + (3--4)^2}$

$\sqrt{(0) + (49)}$

**9)**

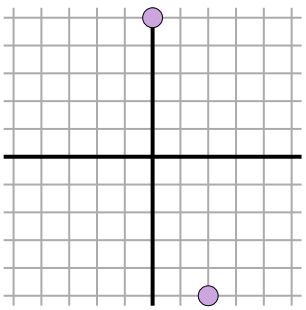

$\sqrt{(0-2)^2 + (5--5)^2}$

$\sqrt{(4) + (100)}$

**10)**

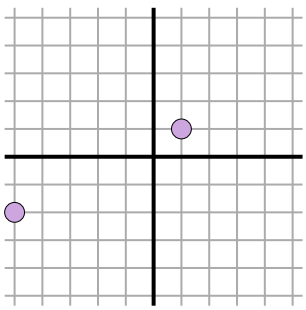

$\sqrt{(1--5)^2 + (1--2)^2}$

$\sqrt{(36) + (9)}$

**11)**

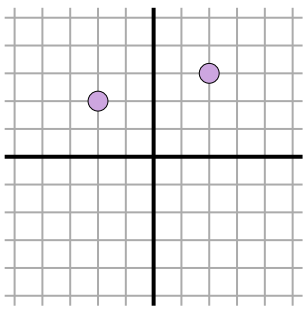

$\sqrt{(2--2)^2 + (3-2)^2}$

$\sqrt{(16) + (1)}$

**Câu trả lời**

| | |
|---|---|
| Vd. | 5 |
| 1. | 9,2 |
| 2. | 5,1 |
| 3. | 5,7 |
| 4. | 10,6 |
| 5. | 4,2 |
| 6. | 7,3 |
| 7. | 5,8 |
| 8. | 7 |
| 9. | 10,2 |
| 10. | 6,7 |
| 11. | 4,1 |



| | | | | | | | | | | |
|---|---|---|---|---|---|---|---|---|---|---|
| 1-10 | 91 | 82 | 73 | 64 | 55 | 45 | 36 | 27 | 18 | 9 |
| 11 | 0 | | | | | | | | | |