Tạo hình chữ nhật với lưới tọa độ

Họ và Tên:

Tìm tọa độ điểm D để tạo thành hình chữ nhật.

Vd)

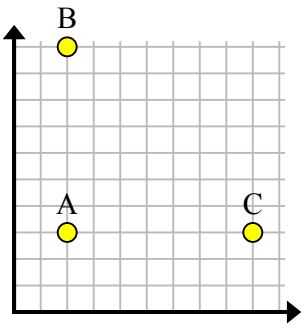

1)

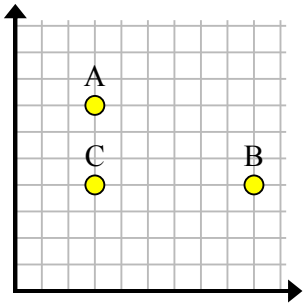

2)

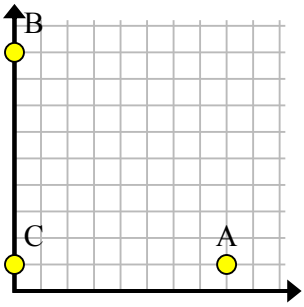

3)

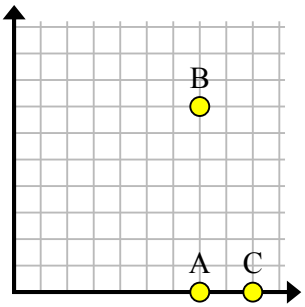

4)

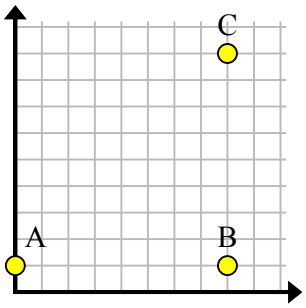

5)

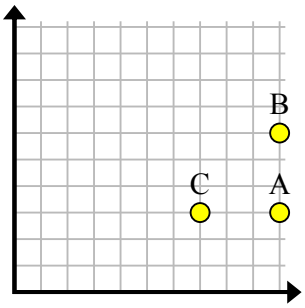

6)

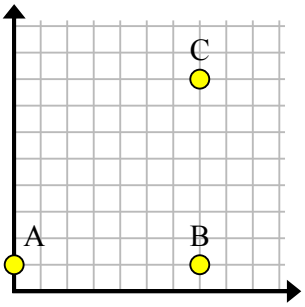

7)

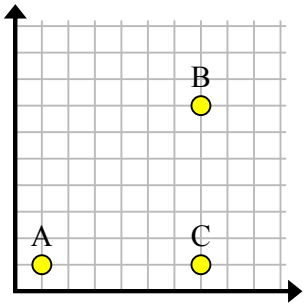

8)

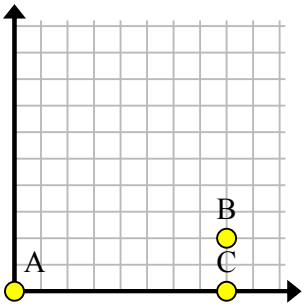

9)

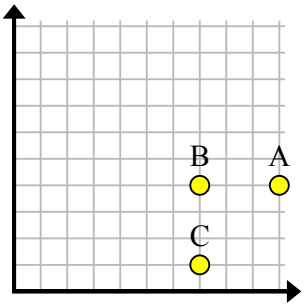

10)

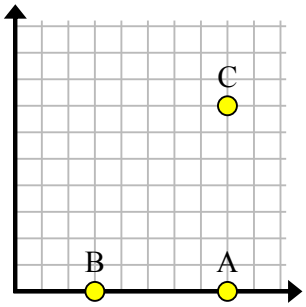

11)

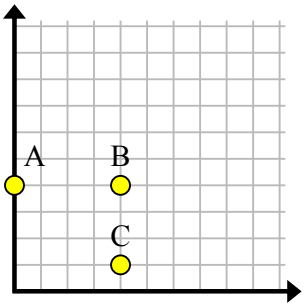

Câu trả lời

Vd. (9 , 10)

1. _____
2. _____
3. _____
4. _____
5. _____
6. _____
7. _____
8. _____
9. _____
10. _____
11. _____

Tạo hình chữ nhật với lưới tọa độ

Họ và Tên: **Lời giải**

Tìm tọa độ điểm D để tạo thành hình chữ nhật.

Vd)

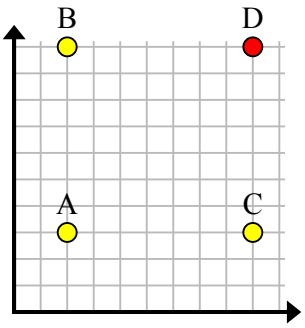

1)

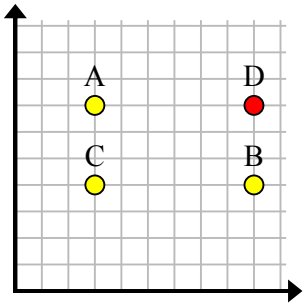

2)

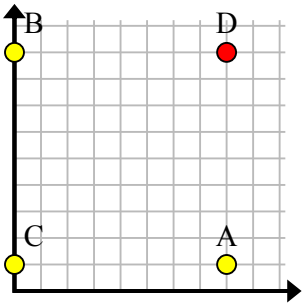

3)

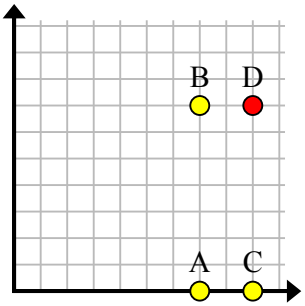

4)

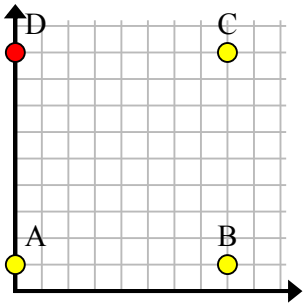

5)

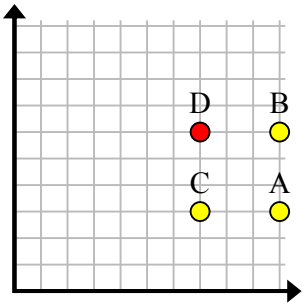

6)

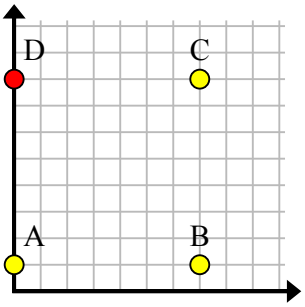

7)

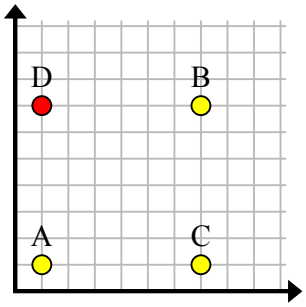

8)

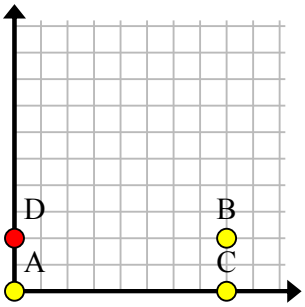

9)

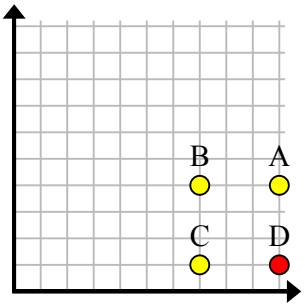

10)

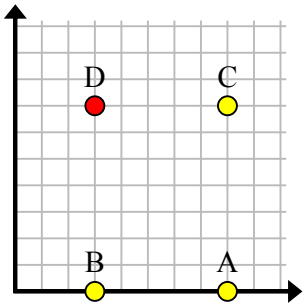

11)

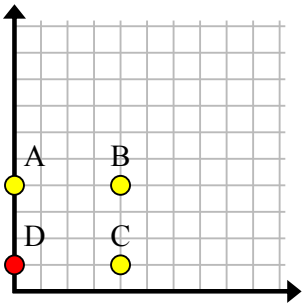

Câu trả lời

Vd.	(9, 10)
1.	(9, 7)
2.	(8, 9)
3.	(9, 7)
4.	(0, 9)
5.	(7, 6)
6.	(0, 8)
7.	(1, 7)
8.	(0, 2)
9.	(10, 1)
10.	(3, 7)
11.	(0, 1)