Tạo hình chữ nhật với lưới tọa độ

Họ và Tên:

Tìm tọa độ điểm D để tạo thành hình chữ nhật.

Vd)

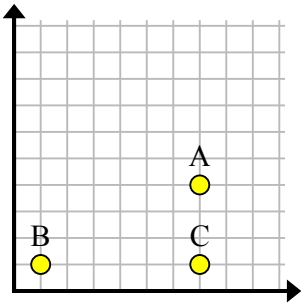

1)

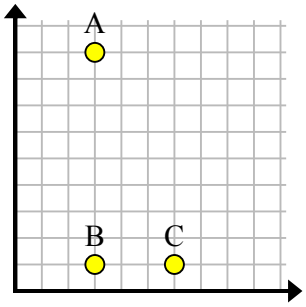

2)

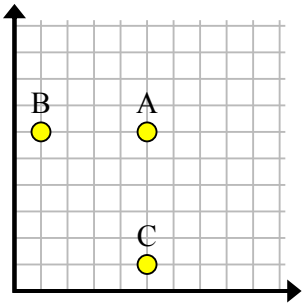

3)

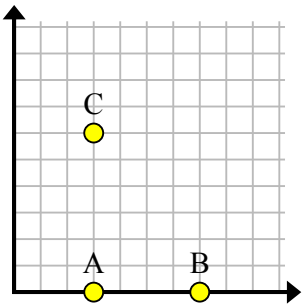

4)

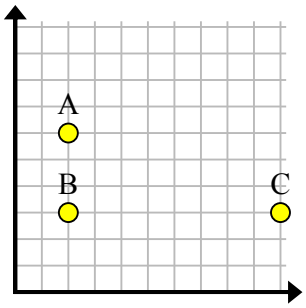

5)

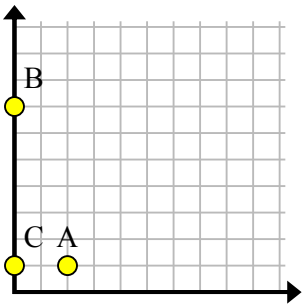

6)

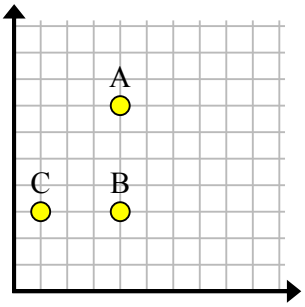

7)

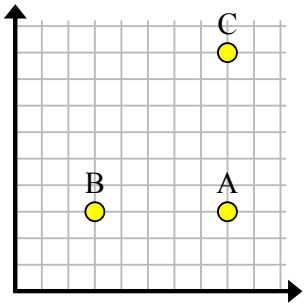

8)

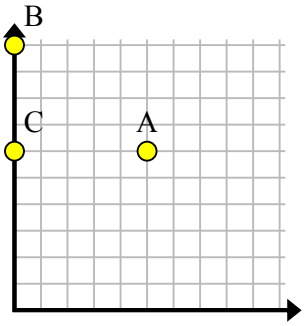

9)

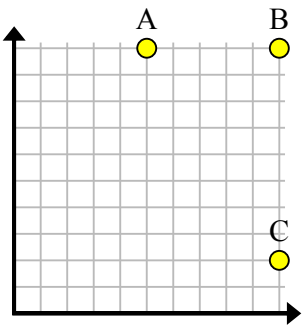

10)

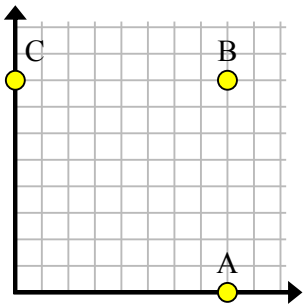

11)

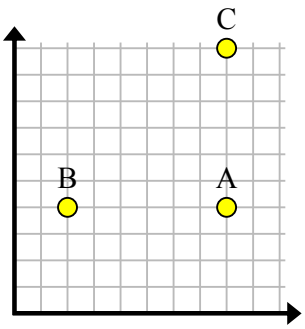

Câu trả lời

Vd. (1, 4)

1. _____

2. _____

3. _____

4. _____

5. _____

6. _____

7. _____

8. _____

9. _____

10. _____

11. _____

1-10	91	82	73	64	55	45	36	27	18	9
11	0									

Tạo hình chữ nhật với lưới tọa độ

Họ và Tên: **Lời giải**

Tìm tọa độ điểm D để tạo thành hình chữ nhật.

Vd)

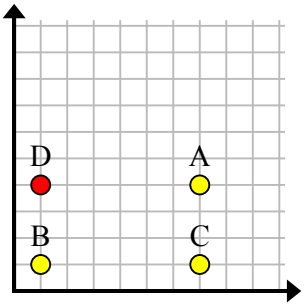

1)

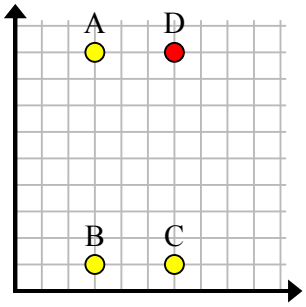

2)

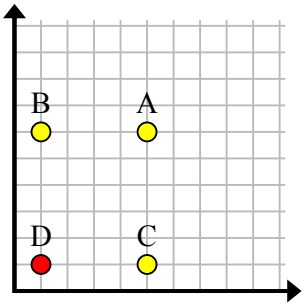

3)

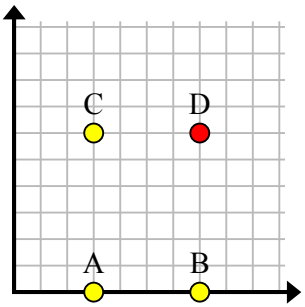

4)

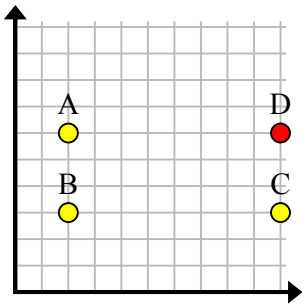

5)

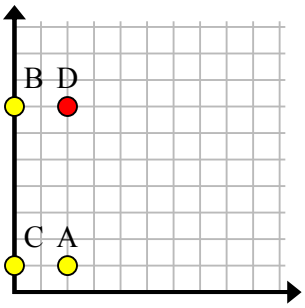

6)

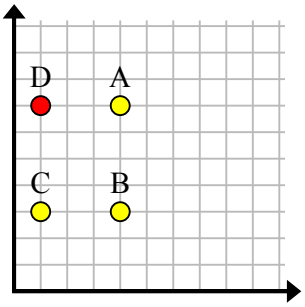

7)

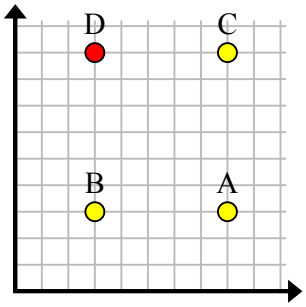

8)

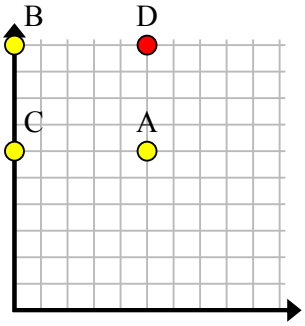

9)

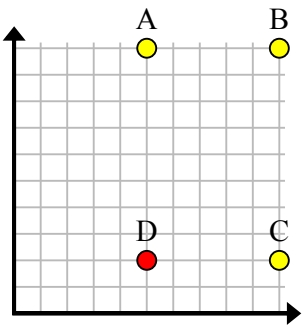

10)

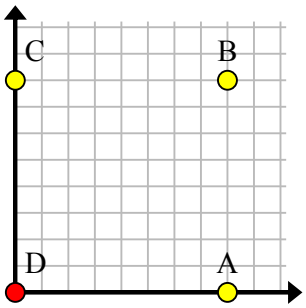

11)

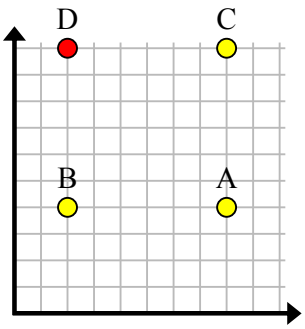

Câu trả lời

Vd.	(1, 4)
1.	(6, 9)
2.	(1, 1)
3.	(7, 6)
4.	(10, 6)
5.	(2, 7)
6.	(1, 7)
7.	(3, 9)
8.	(5, 10)
9.	(5, 2)
10.	(0, 0)
11.	(2, 10)

1-10	91	82	73	64	55	45	36	27	18	9
11	0									