Phép chia với trục số

Họ và Tên:

Dùng trục số để giải biểu thức.

1) 10:2=

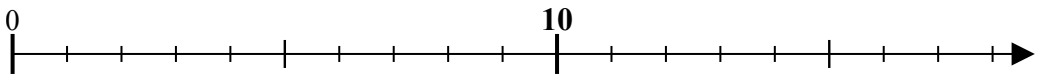

2) 6:3=

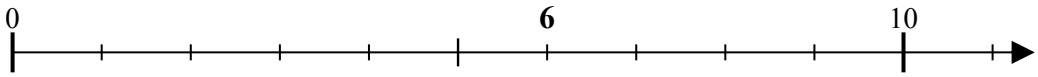

3) 14:7=

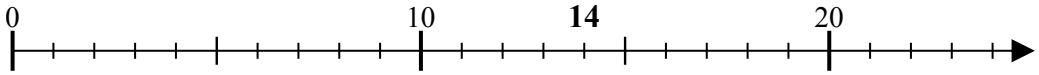

4) 12:6=

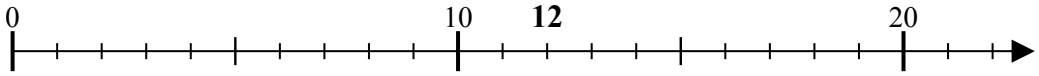

5) 30:10=

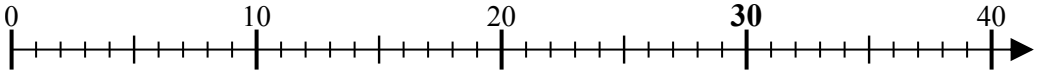

6) 12:3=

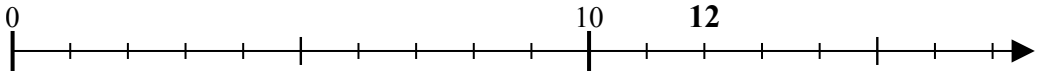

7) 18:9=

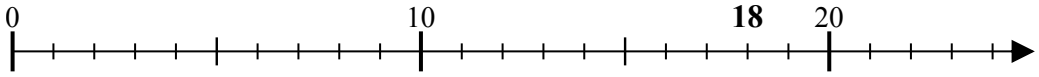

8) 40:8=

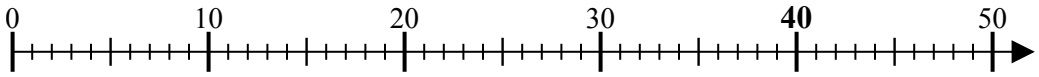

9) 8:4=

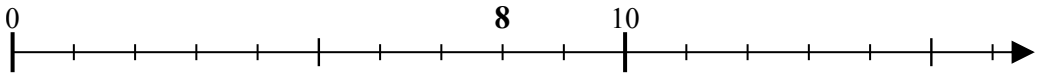

10) 20:10=

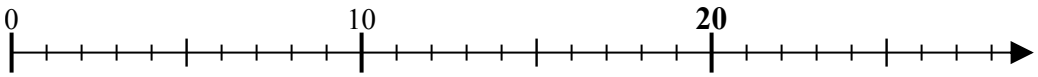

11) 20:4=

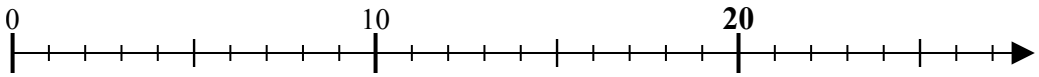

Câu trả lời

1. _____
2. _____
3. _____
4. _____
5. _____
6. _____
7. _____
8. _____
9. _____
10. _____
11. _____

1-10	91	82	73	64	55	45	36	27	18	9
11	0									

Phép chia với trục số

Họ và Tên: **Lời giải**

Dùng trục số để giải biểu thức.

1) 10:2=

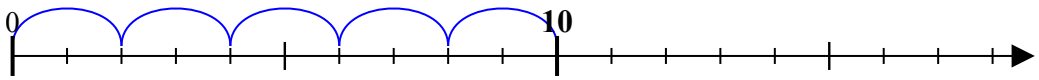

2) 6:3=

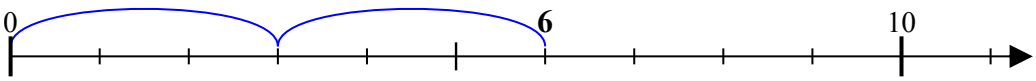

3) 14:7=

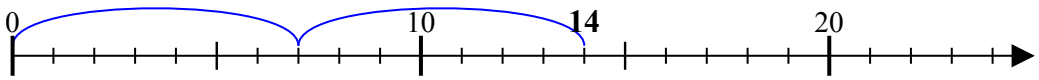

4) 12:6=

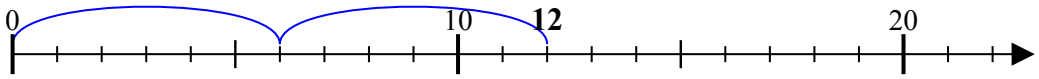

5) 30:10=

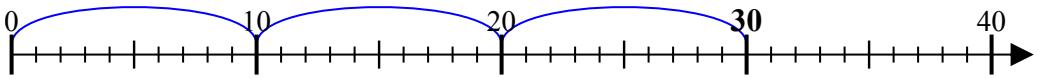

6) 12:3=

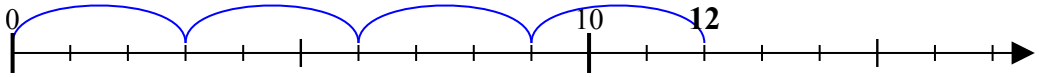

7) 18:9=

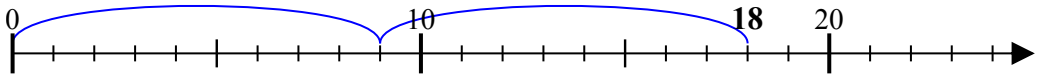

8) 40:8=

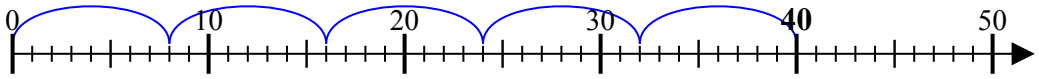

9) 8:4=

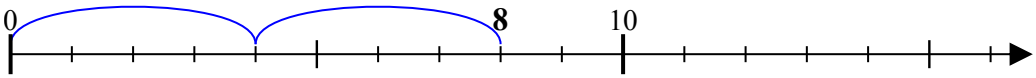

10) 20:10=

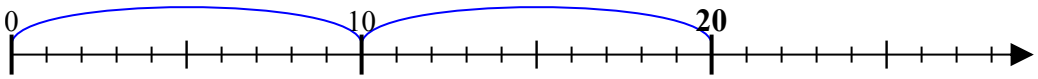

11) 20:4=

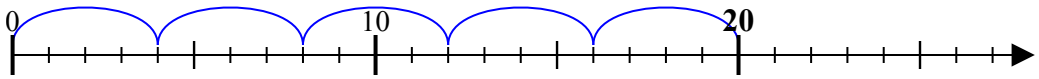

Câu trả lời

1. 5
2. 2
3. 2
4. 2
5. 3
6. 4
7. 2
8. 5
9. 2
10. 2
11. 5