Phép chia với trục số

Họ và Tên:

Dùng trục số để giải biểu thức.

1) 9:3=

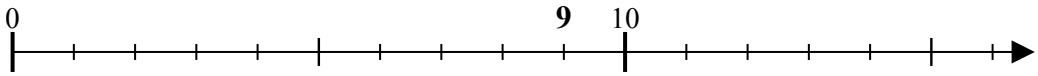

2) 6:2=

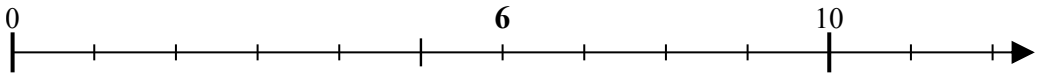

3) 12:4=

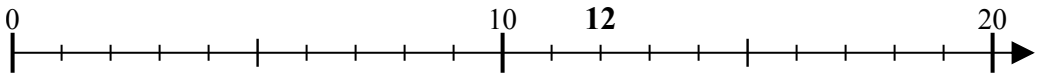

4) 15:5=

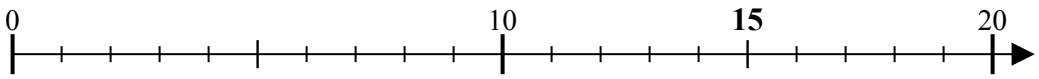

5) 28:7=

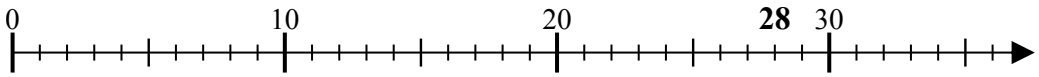

6) 40:10=

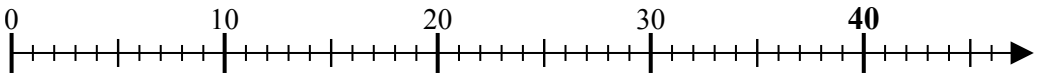

7) 24:6=

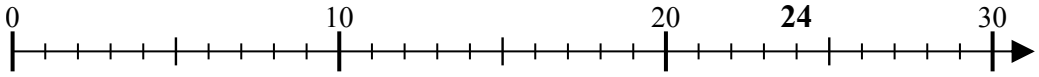

8) 30:10=

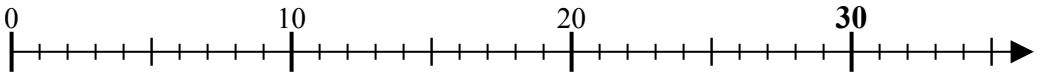

9) 30:6=

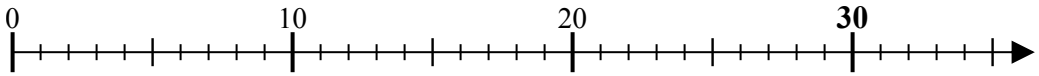

10) 12:3=

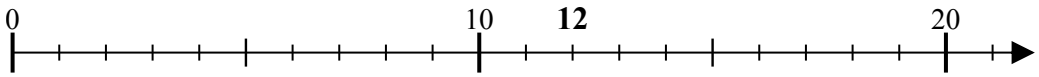

11) 18:6=

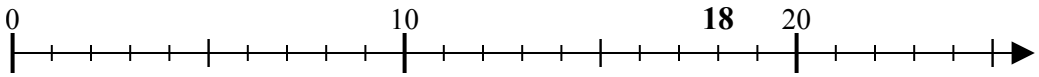

Câu trả lời

1. _____
2. _____
3. _____
4. _____
5. _____
6. _____
7. _____
8. _____
9. _____
10. _____
11. _____

1-10	91	82	73	64	55	45	36	27	18	9
11	0									

Phép chia với trục số

Họ và Tên: **Lời giải**

Dùng trục số để giải biểu thức.

1) 9:3=

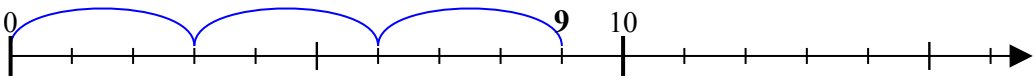

2) 6:2=

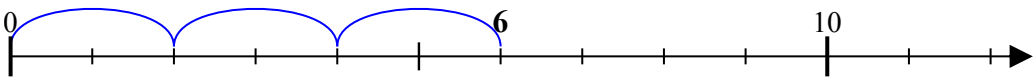

3) 12:4=

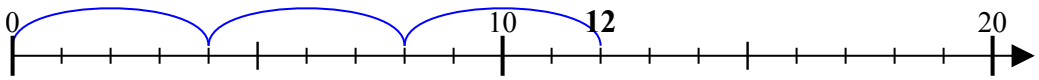

4) 15:5=

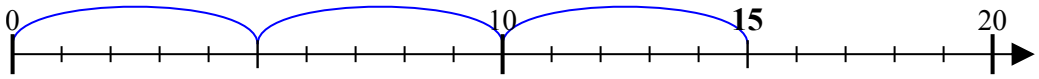

5) 28:7=

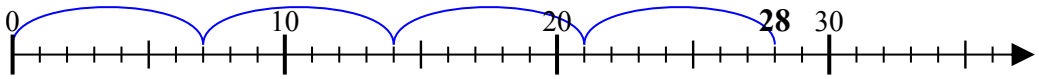

6) 40:10=

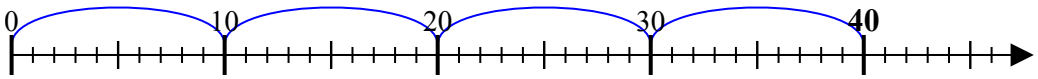

7) 24:6=

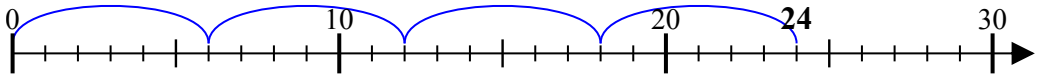

8) 30:10=

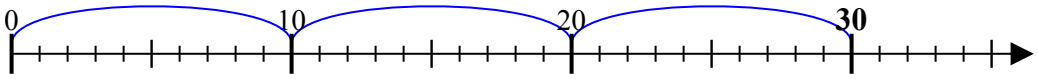

9) 30:6=

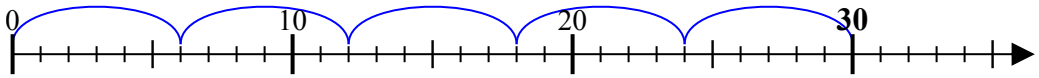

10) 12:3=

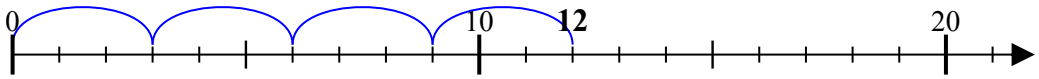

11) 18:6=

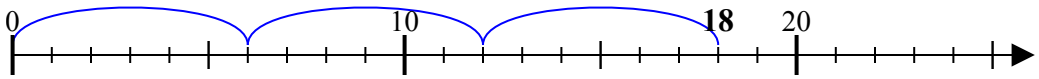

Câu trả lời

1. 3
2. 3
3. 3
4. 3
5. 4
6. 4
7. 4
8. 3
9. 5
10. 4
11. 3

1-10	91	82	73	64	55	45	36	27	18	9
11	0									

Phép chia với trục số

Họ và Tên:

Dùng trục số để giải biểu thức.

1) 15:5=

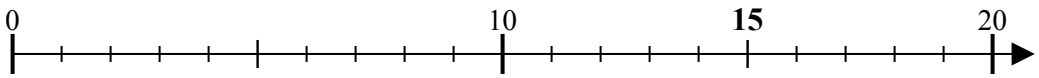

2) 16:8=

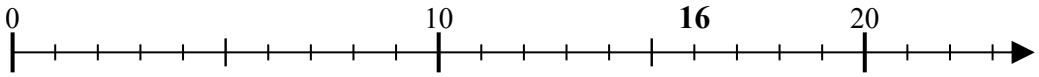

3) 8:2=

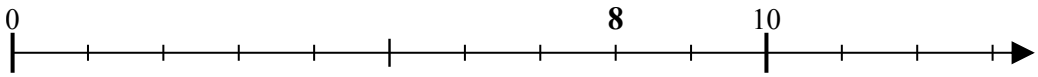

4) 36:9=

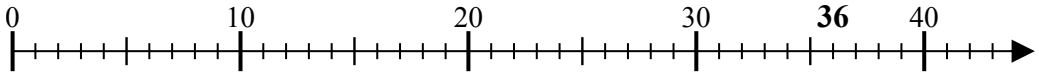

5) 10:5=

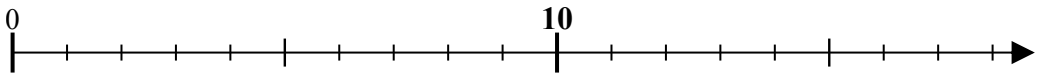

6) 16:4=

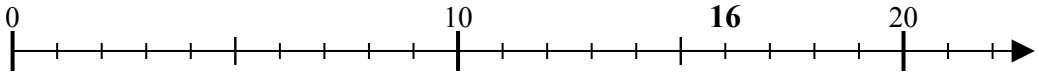

7) 6:2=

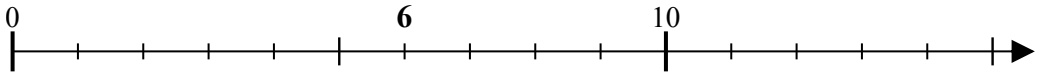

8) 12:6=

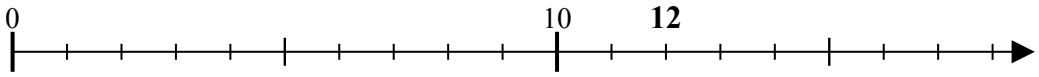

9) 6:3=

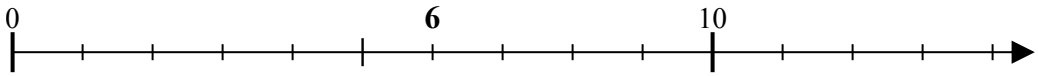

10) 18:9=

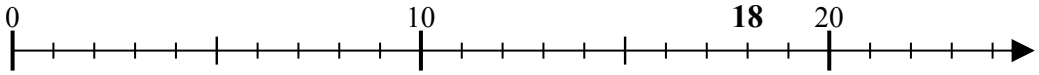

11) 45:9=

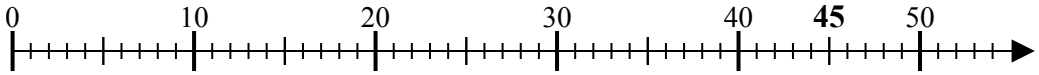

Câu trả lời

1. _____
2. _____
3. _____
4. _____
5. _____
6. _____
7. _____
8. _____
9. _____
10. _____
11. _____

1-10	91	82	73	64	55	45	36	27	18	9
11	0									

Phép chia với trục số

Họ và Tên: **Lời giải**

Dùng trục số để giải biểu thức.

1) 15:5=

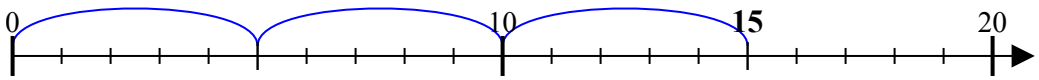

2) 16:8=

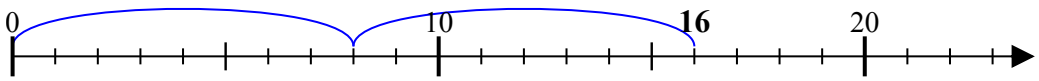

3) 8:2=

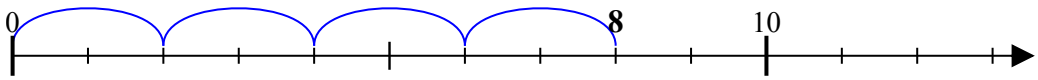

4) 36:9=

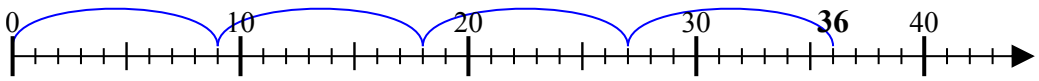

5) 10:5=

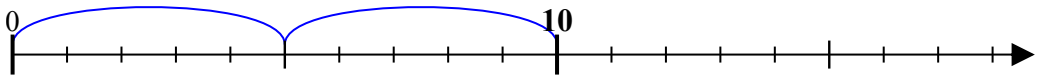

6) 16:4=

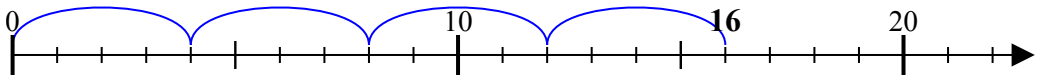

7) 6:2=

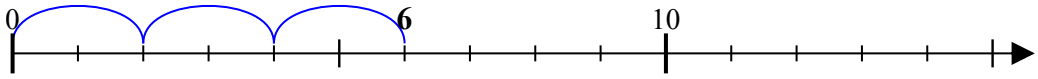

8) 12:6=

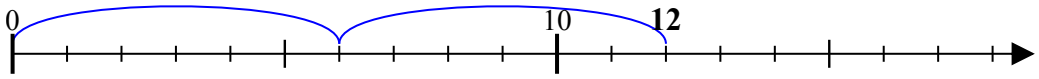

9) 6:3=

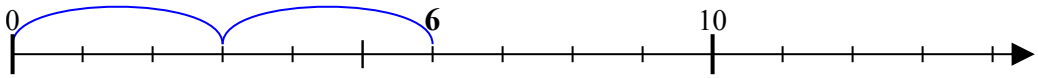

10) 18:9=

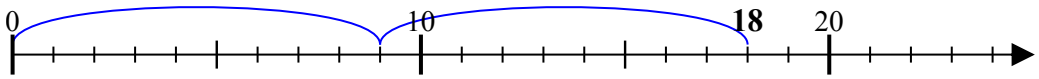

11) 45:9=

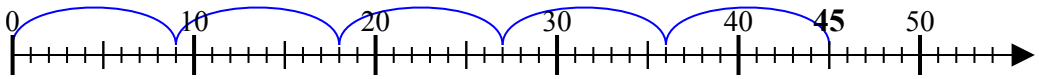

Câu trả lời

1. 3
2. 2
3. 4
4. 4
5. 2
6. 4
7. 3
8. 2
9. 2
10. 2
11. 5

1-10	91	82	73	64	55	45	36	27	18	9
11	0									

Phép chia với trục số

Họ và Tên:

Dùng trục số để giải biểu thức.

1) 30:10=

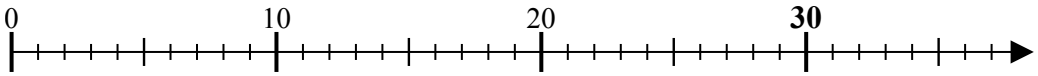

2) 28:7=

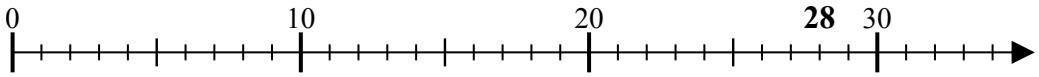

3) 6:3=

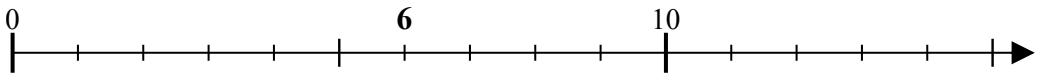

4) 32:8=

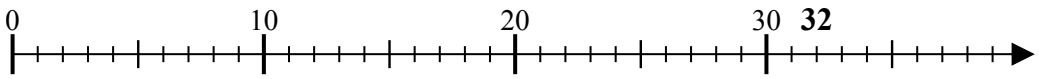

5) 15:3=

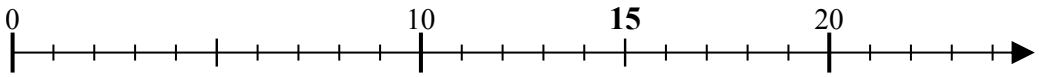

6) 10:5=

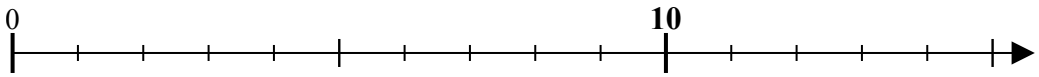

7) 18:6=

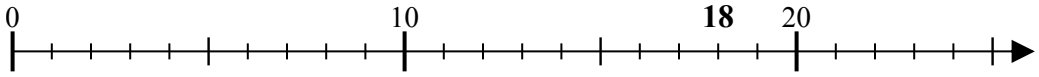

8) 20:10=

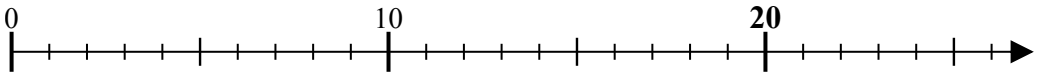

9) 36:9=

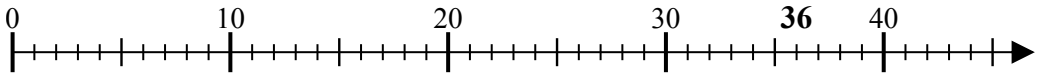

10) 20:4=

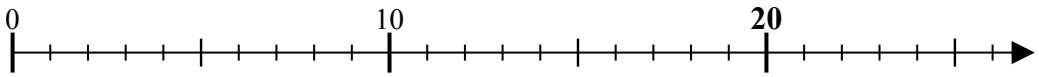

11) 9:3=

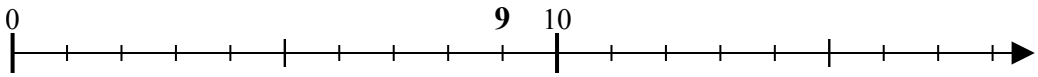

Câu trả lời

1. _____
2. _____
3. _____
4. _____
5. _____
6. _____
7. _____
8. _____
9. _____
10. _____
11. _____

1-10	91	82	73	64	55	45	36	27	18	9
11	0									

Dùng trục số để giải biểu thức.

1) 30:10=

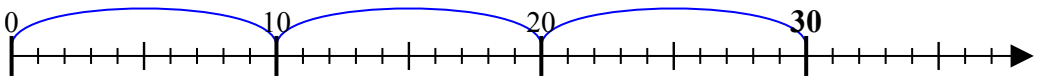

2) 28:7=

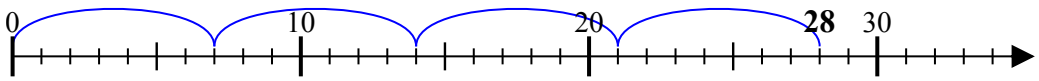

3) 6:3=

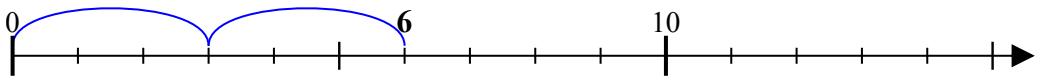

4) 32:8=

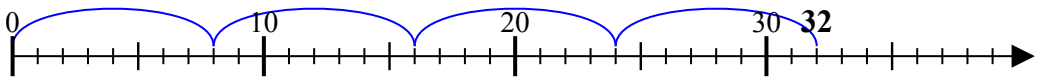

5) 15:3=

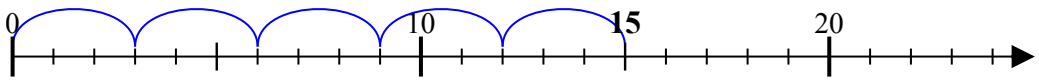

6) 10:5=

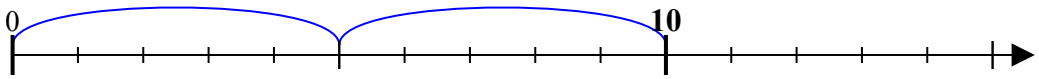

7) 18:6=

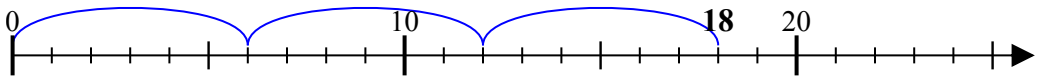

8) 20:10=

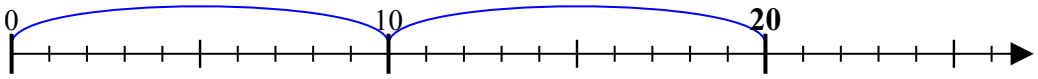

9) 36:9=

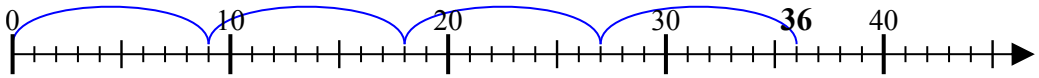

10) 20:4=

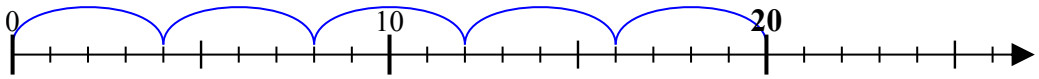

11) 9:3=

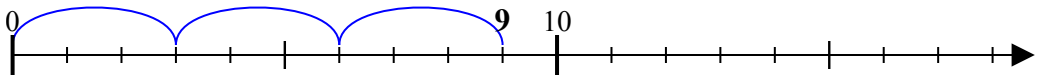

Câu trả lời

1. 3
2. 4
3. 2
4. 4
5. 5
6. 2
7. 3
8. 2
9. 4
10. 5
11. 3

1-10	91	82	73	64	55	45	36	27	18	9
11	0									

Phép chia với trục số

Họ và Tên:

Dùng trục số để giải biểu thức.

1) 9:3=

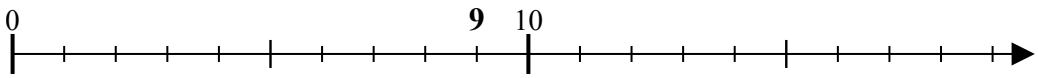

2) 10:5=

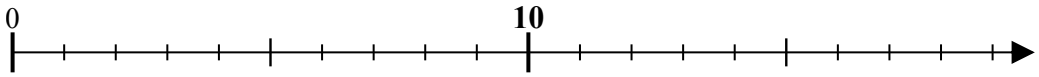

3) 32:8=

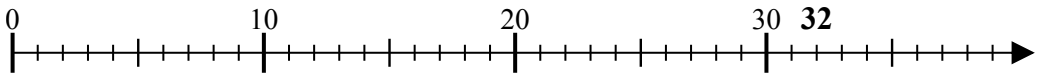

4) 8:2=

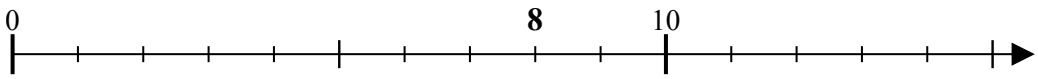

5) 24:6=

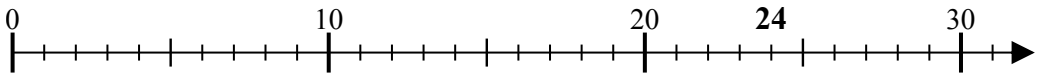

6) 8:4=

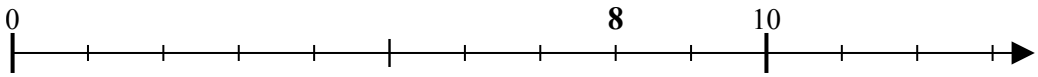

7) 4:2=

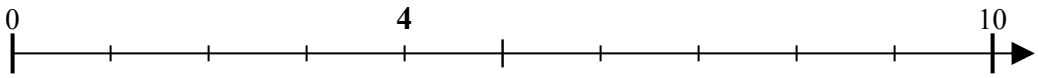

8) 30:6=

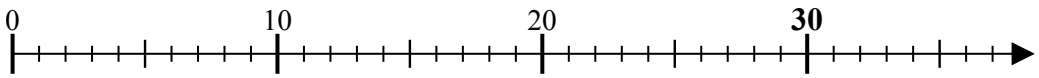

9) 20:4=

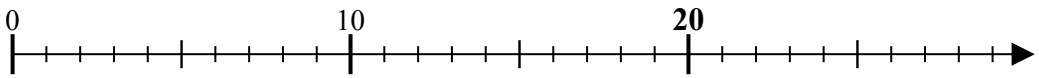

10) 12:4=

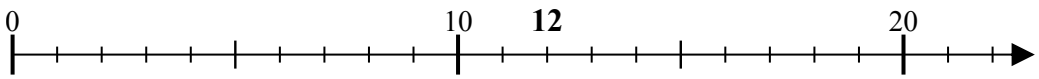

11) 50:10=

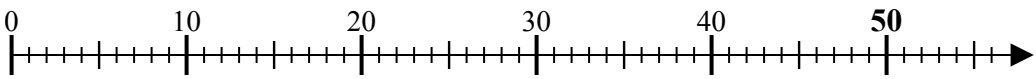

Câu trả lời

1. _____
2. _____
3. _____
4. _____
5. _____
6. _____
7. _____
8. _____
9. _____
10. _____
11. _____

1-10	91	82	73	64	55	45	36	27	18	9
11	0									

Phép chia với trục số

Họ và Tên: **Lời giải**

Dùng trục số để giải biểu thức.

1) 9:3=

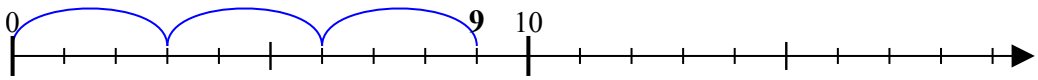

2) 10:5=

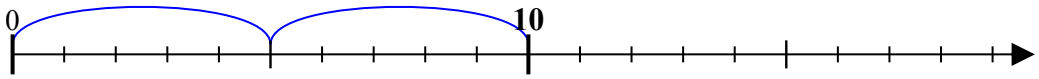

3) 32:8=

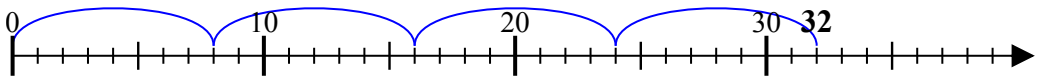

4) 8:2=

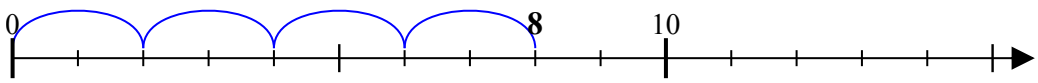

5) 24:6=

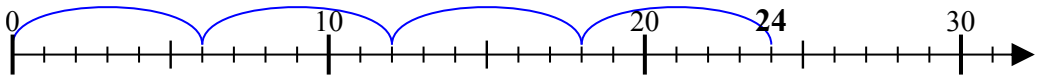

6) 8:4=

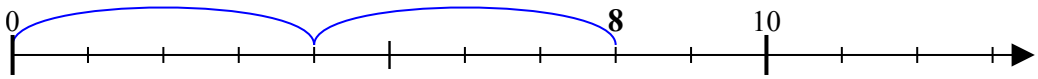

7) 4:2=

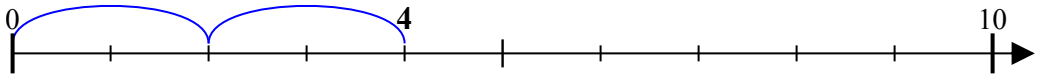

8) 30:6=

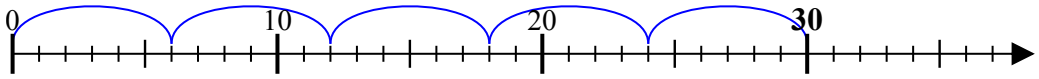

9) 20:4=

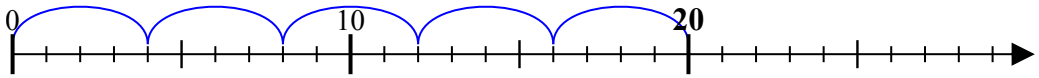

10) 12:4=

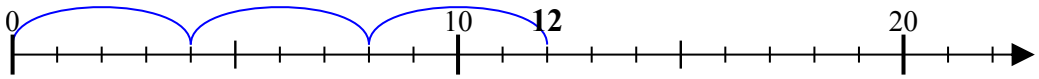

11) 50:10=

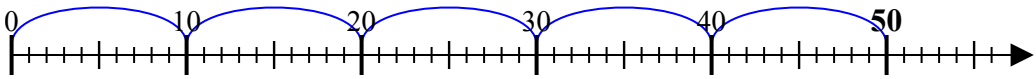

Câu trả lời

1. 3
2. 2
3. 4
4. 4
5. 4
6. 2
7. 2
8. 5
9. 5
10. 3
11. 5

1-10	91	82	73	64	55	45	36	27	18	9
11	0									

Phép chia với trục số

Họ và Tên:

Dùng trục số để giải biểu thức.

1) 35:7=

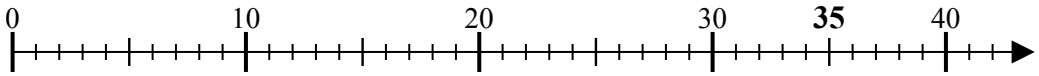

2) 21:7=

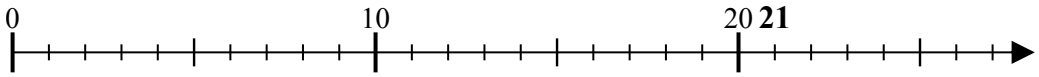

3) 12:6=

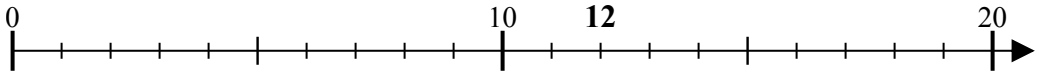

4) 6:2=

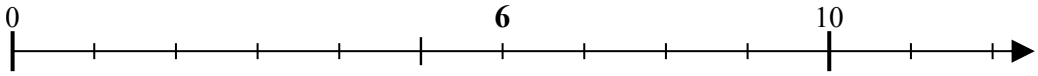

5) 28:7=

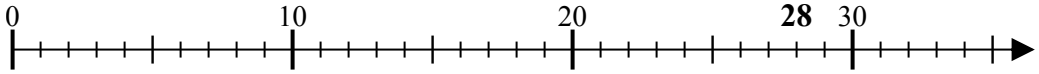

6) 10:2=

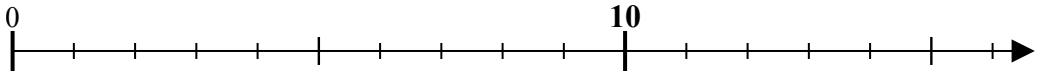

7) 9:3=

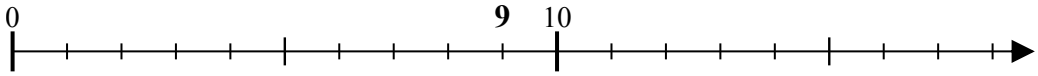

8) 18:6=

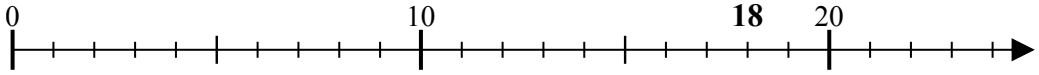

9) 10:5=

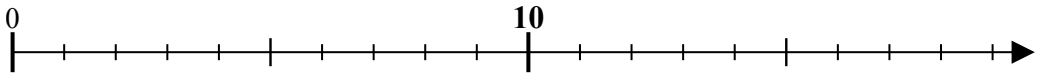

10) 18:9=

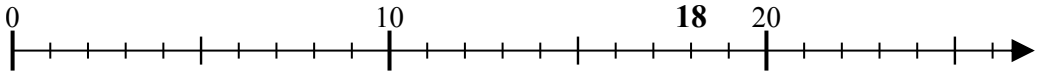

11) 24:6=

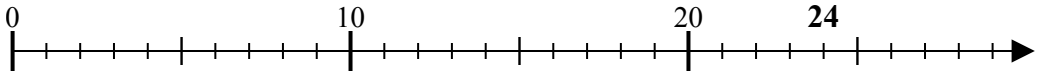

Câu trả lời

1. _____
2. _____
3. _____
4. _____
5. _____
6. _____
7. _____
8. _____
9. _____
10. _____
11. _____

1-10	91	82	73	64	55	45	36	27	18	9
11	0									

Dùng trục số để giải biểu thức.

1) 35:7=

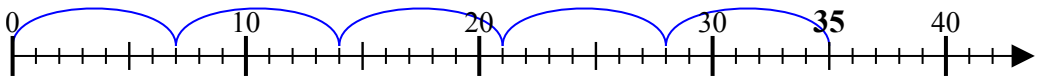

2) 21:7=

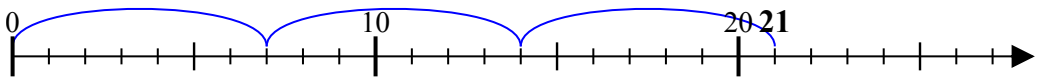

3) 12:6=

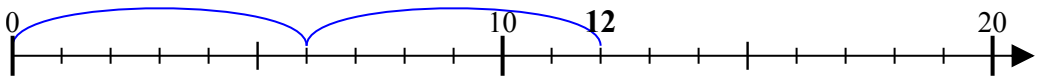

4) 6:2=

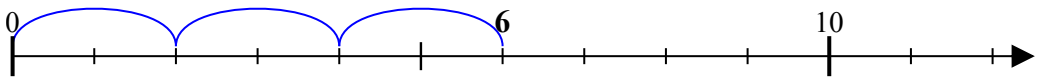

5) 28:7=

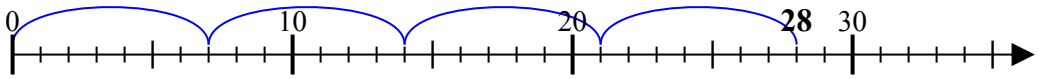

6) 10:2=

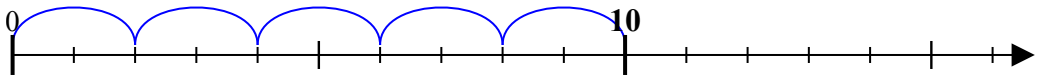

7) 9:3=

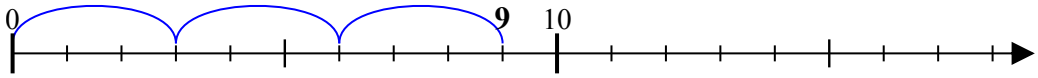

8) 18:6=

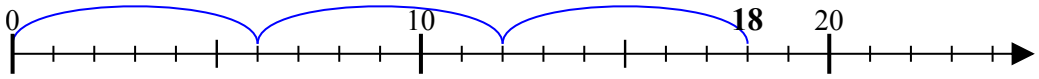

9) 10:5=

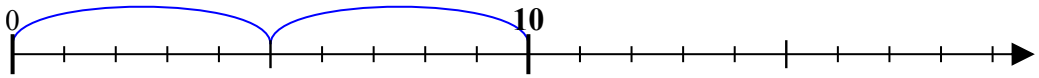

10) 18:9=

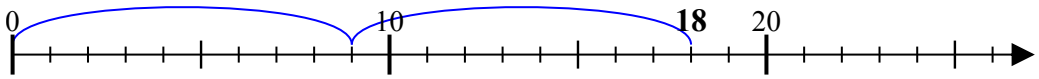

11) 24:6=

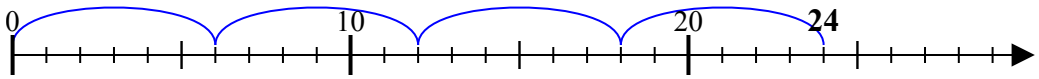

Câu trả lời

1. 5
2. 3
3. 2
4. 3
5. 4
6. 5
7. 3
8. 3
9. 2
10. 2
11. 4

1-10	91	82	73	64	55	45	36	27	18	9
11	0									

Dùng trục số để giải biểu thức.

1) 12:6=

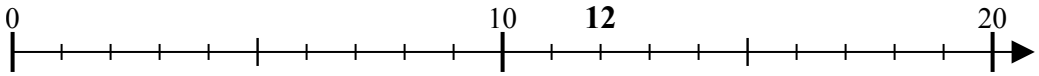

2) 50:10=

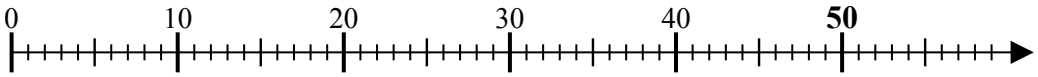

3) 6:2=

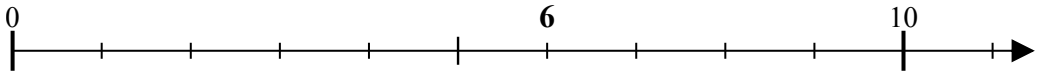

4) 10:5=

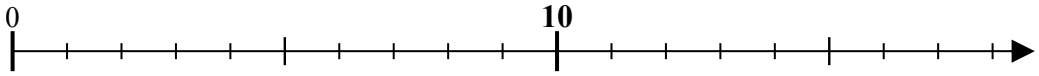

5) 16:8=

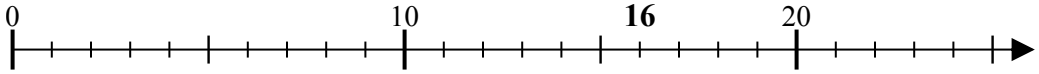

6) 8:2=

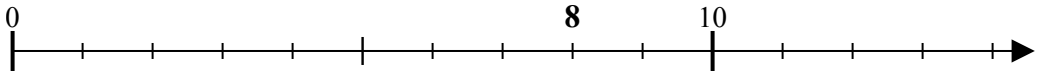

7) 35:7=

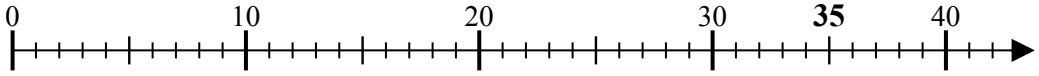

8) 40:10=

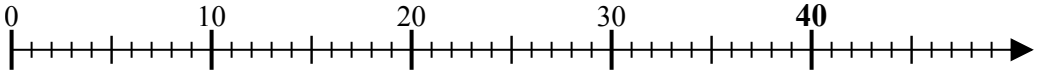

9) 18:6=

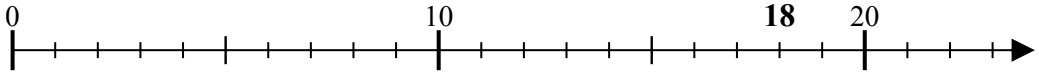

10) 25:5=

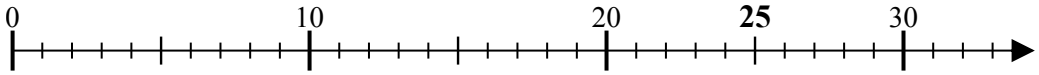

11) 30:6=

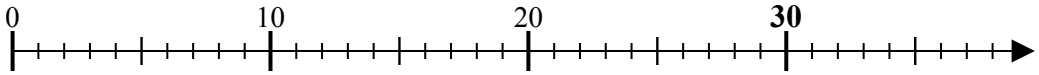

Câu trả lời

1. _____
2. _____
3. _____
4. _____
5. _____
6. _____
7. _____
8. _____
9. _____
10. _____
11. _____

1-10	91	82	73	64	55	45	36	27	18	9
11	0									

Dùng trục số để giải biểu thức.

1) 12:6=

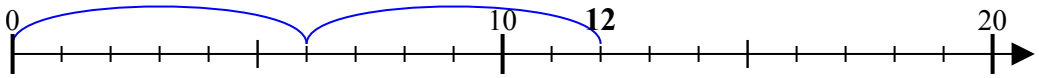

2) 50:10=

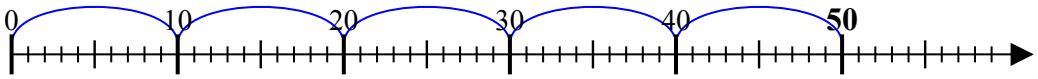

3) 6:2=

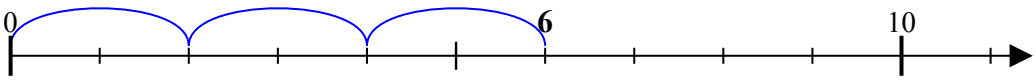

4) 10:5=

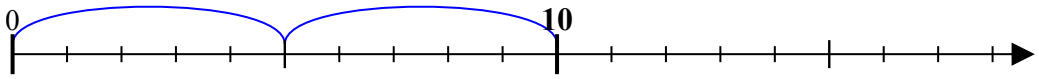

5) 16:8=

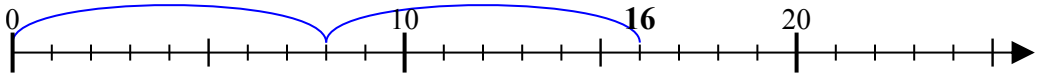

6) 8:2=

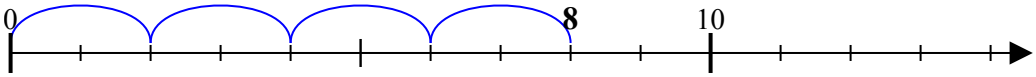

7) 35:7=

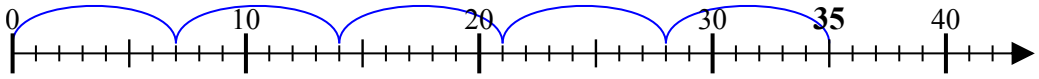

8) 40:10=

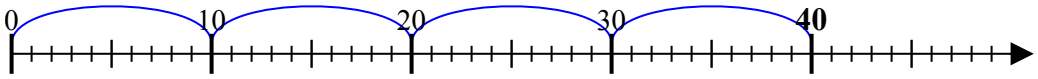

9) 18:6=

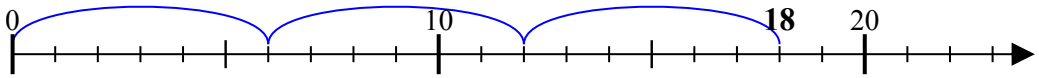

10) 25:5=

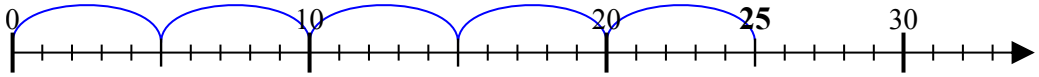

11) 30:6=

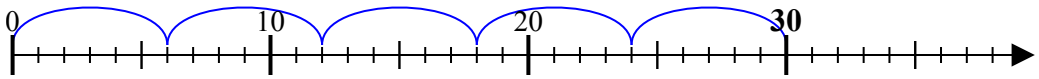

Câu trả lời

1. **2**
2. **5**
3. **3**
4. **2**
5. **2**
6. **4**
7. **5**
8. **4**
9. **3**
10. **5**
11. **5**

1-10	91	82	73	64	55	45	36	27	18	9
11	0									

Phép chia với trục số

Họ và Tên:

Dùng trục số để giải biểu thức.

1) 24:6=

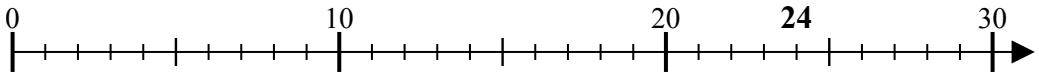

2) 16:8=

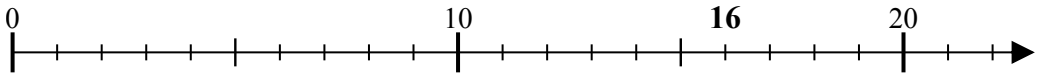

3) 10:2=

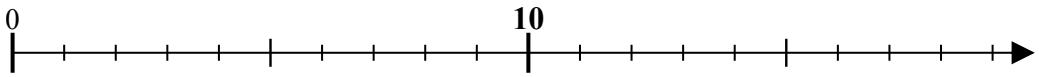

4) 40:8=

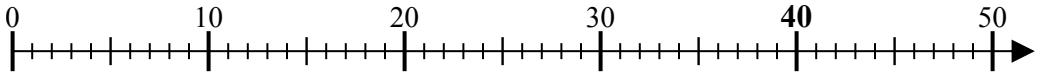

5) 6:2=

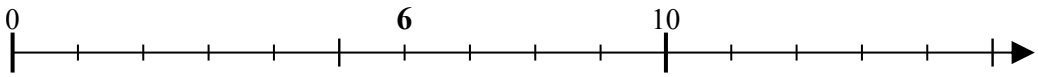

6) 40:10=

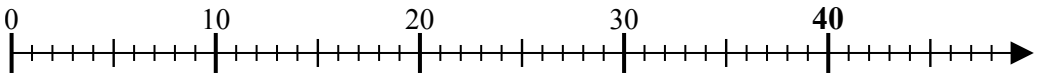

7) 15:3=

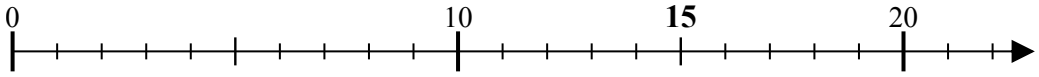

8) 18:9=

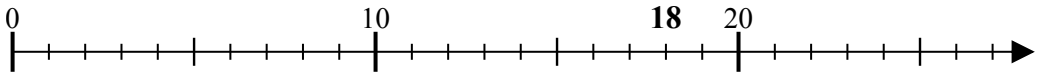

9) 27:9=

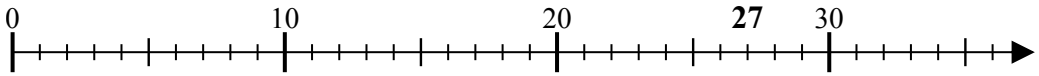

10) 36:9=

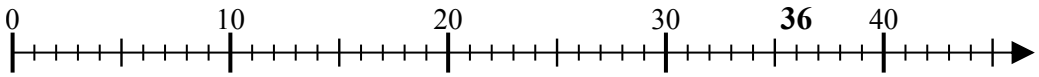

11) 8:4=

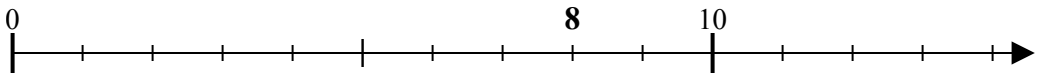

Câu trả lời

1. _____
2. _____
3. _____
4. _____
5. _____
6. _____
7. _____
8. _____
9. _____
10. _____
11. _____

1-10	91	82	73	64	55	45	36	27	18	9
11	0									

Dùng trục số để giải biểu thức.

1) 24:6=

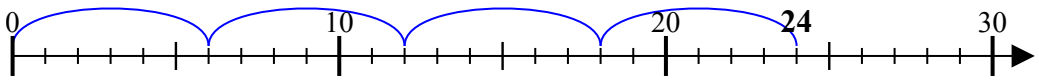

2) 16:8=

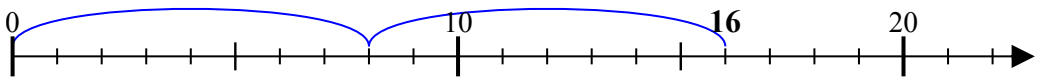

3) 10:2=

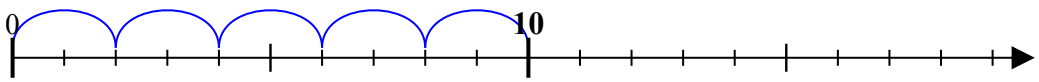

4) 40:8=

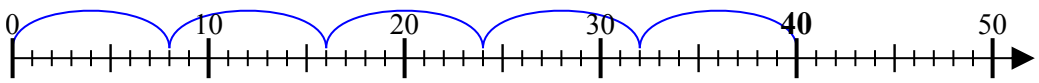

5) 6:2=

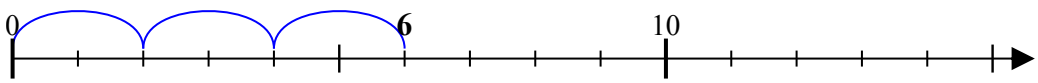

6) 40:10=

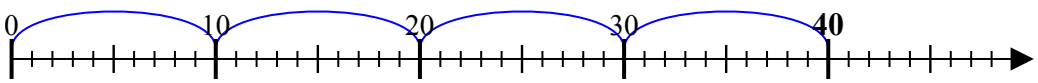

7) 15:3=

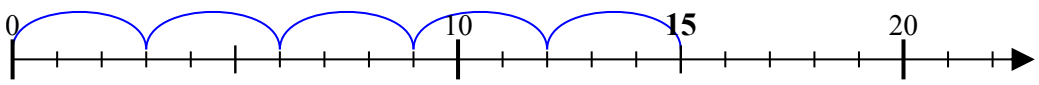

8) 18:9=

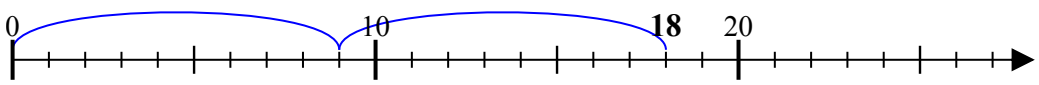

9) 27:9=

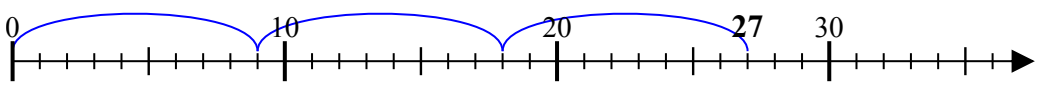

10) 36:9=

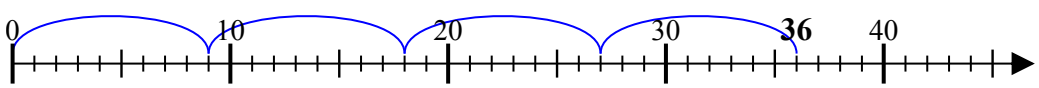

11) 8:4=

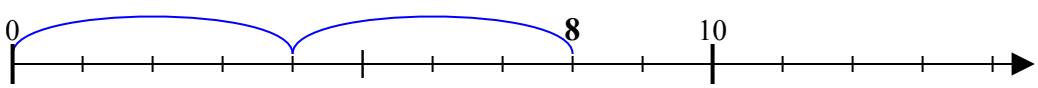

Câu trả lời

1. 4
2. 2
3. 5
4. 5
5. 3
6. 4
7. 5
8. 2
9. 3
10. 4
11. 2

1-10	91	82	73	64	55	45	36	27	18	9
11	0									

Phép chia với trục số

Họ và Tên:

Dùng trục số để giải biểu thức.

1) 50:10=

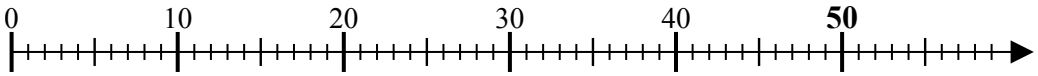

2) 16:4=

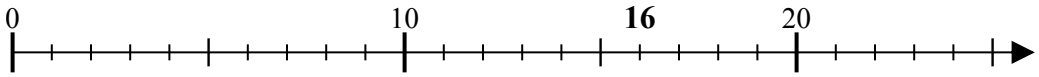

3) 14:7=

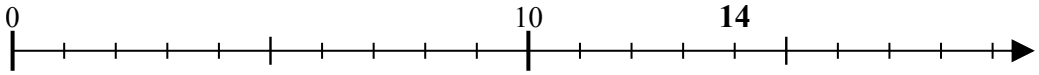

4) 28:7=

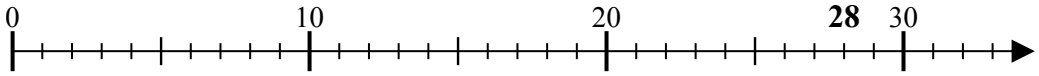

5) 20:4=

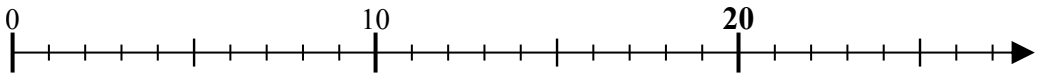

6) 45:9=

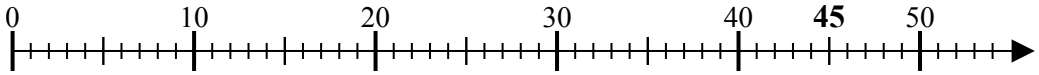

7) 20:10=

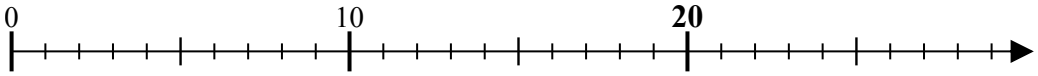

8) 16:8=

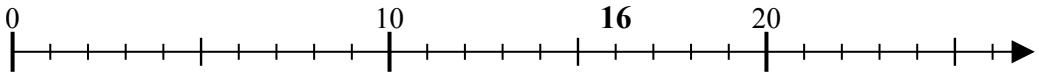

9) 12:4=

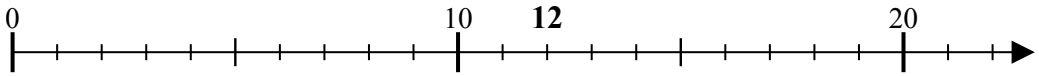

10) 4:2=

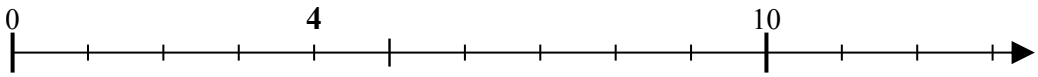

11) 36:9=

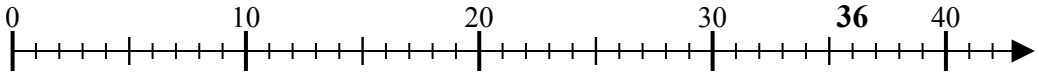

Câu trả lời

1. _____
2. _____
3. _____
4. _____
5. _____
6. _____
7. _____
8. _____
9. _____
10. _____
11. _____

1-10	91	82	73	64	55	45	36	27	18	9
11	0									

Dùng trục số để giải biểu thức.

1) 50:10=

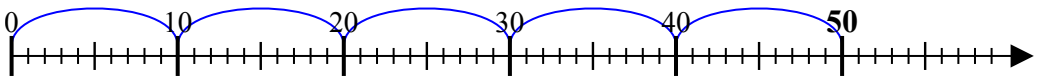

2) 16:4=

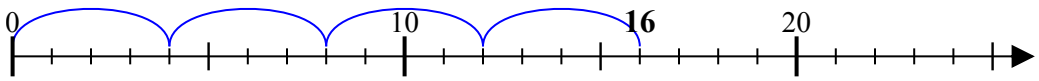

3) 14:7=

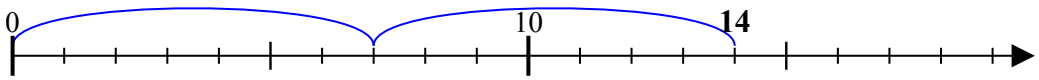

4) 28:7=

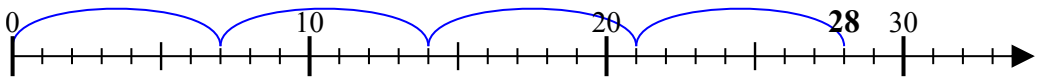

5) 20:4=

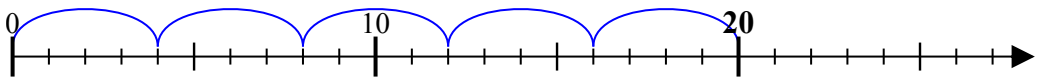

6) 45:9=

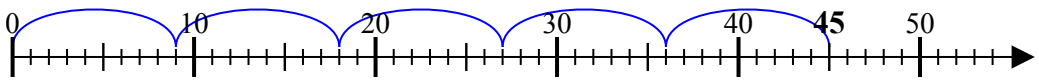

7) 20:10=

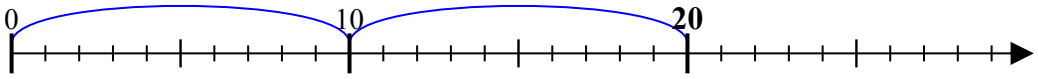

8) 16:8=

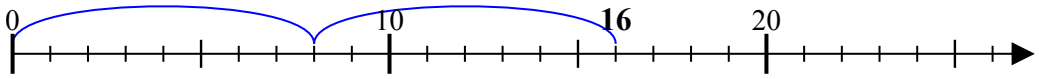

9) 12:4=

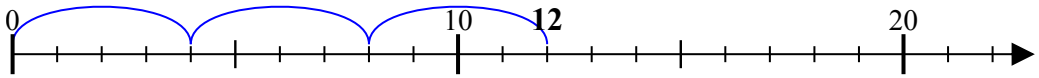

10) 4:2=

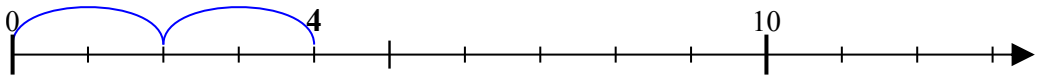

11) 36:9=

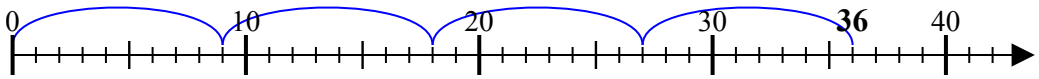

Câu trả lời

1. **5**
2. **4**
3. **2**
4. **4**
5. **5**
6. **5**
7. **2**
8. **2**
9. **3**
10. **2**
11. **4**

1-10	91	82	73	64	55	45	36	27	18	9
11	0									

Phép chia với trục số

Họ và Tên:

Dùng trục số để giải biểu thức.

1) 6:2=

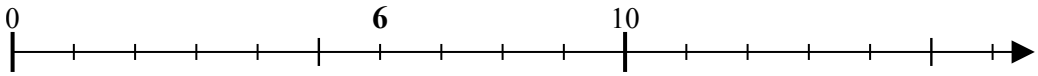

2) 18:9=

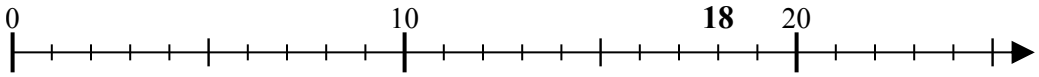

3) 28:7=

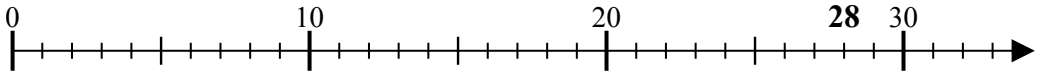

4) 45:9=

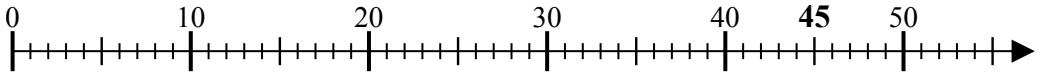

5) 8:4=

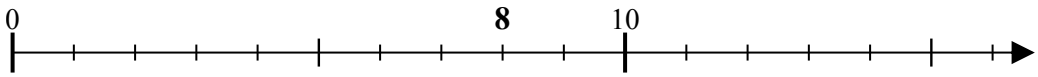

6) 30:10=

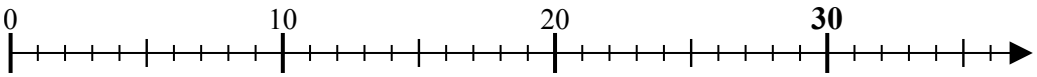

7) 14:7=

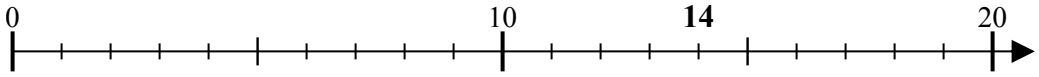

8) 16:4=

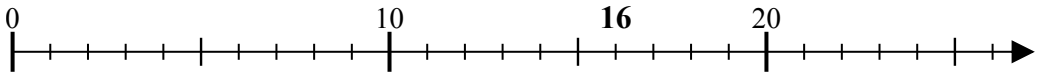

9) 15:3=

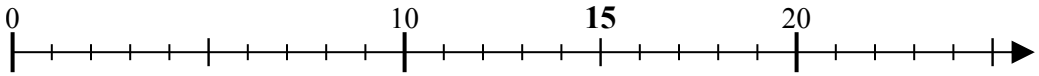

10) 12:6=

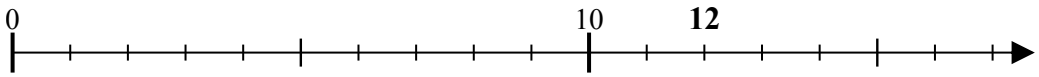

11) 25:5=

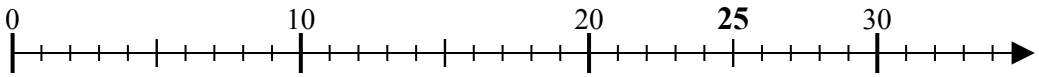

Câu trả lời

1. _____
2. _____
3. _____
4. _____
5. _____
6. _____
7. _____
8. _____
9. _____
10. _____
11. _____

1-10	91	82	73	64	55	45	36	27	18	9
11	0									

Dùng trục số để giải biểu thức.

1) 6:2=

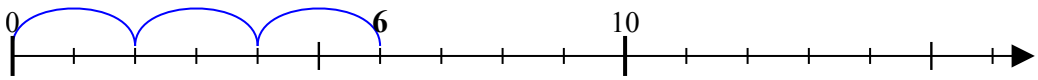

2) 18:9=

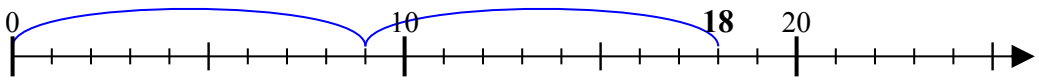

3) 28:7=

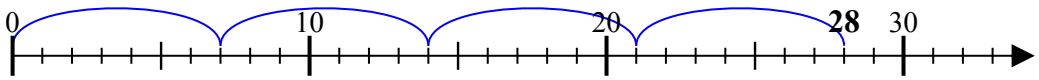

4) 45:9=

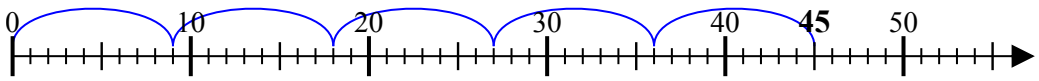

5) 8:4=

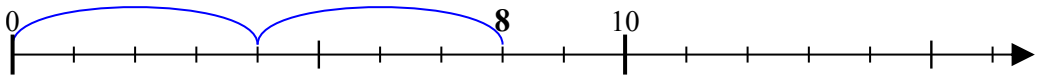

6) 30:10=

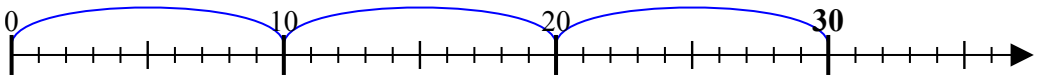

7) 14:7=

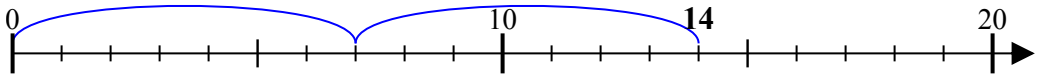

8) 16:4=

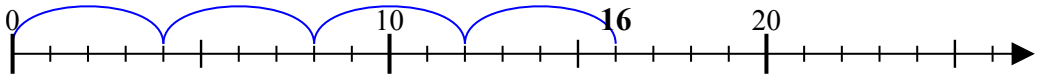

9) 15:3=

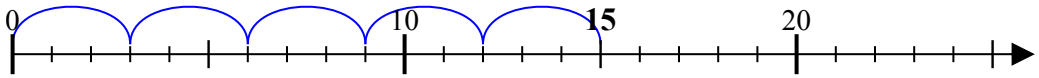

10) 12:6=

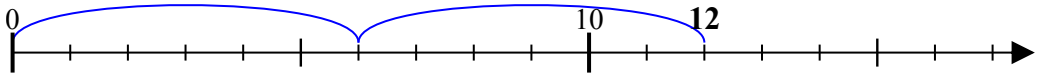

11) 25:5=

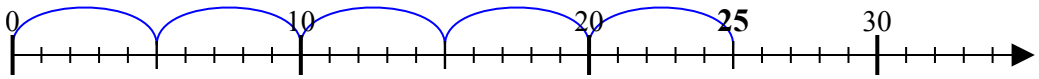

Câu trả lời

1. 3
2. 2
3. 4
4. 5
5. 2
6. 3
7. 2
8. 4
9. 5
10. 2
11. 5

1-10	91	82	73	64	55	45	36	27	18	9
11	0									

Phép chia với trục số

Họ và Tên:

Dùng trục số để giải biểu thức.

1) 18:9=

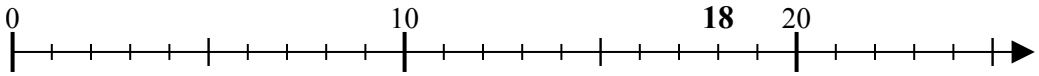

2) 15:5=

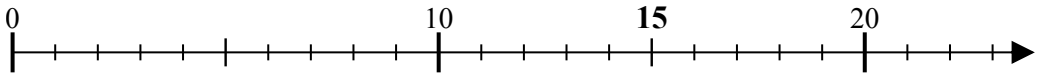

3) 8:2=

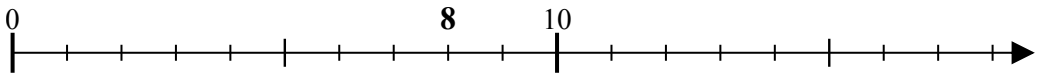

4) 16:4=

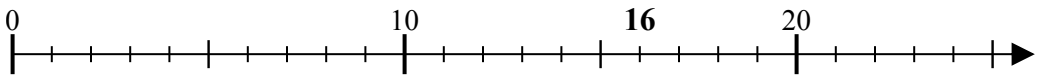

5) 40:10=

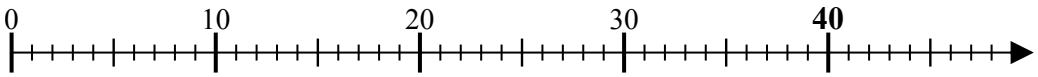

6) 4:2=

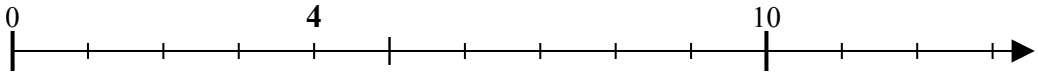

7) 45:9=

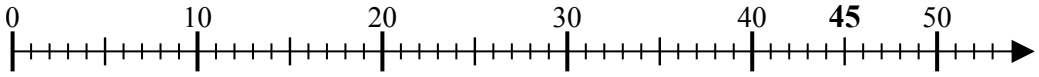

8) 15:3=

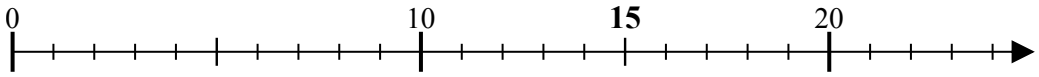

9) 28:7=

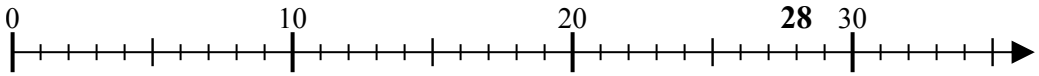

10) 16:8=

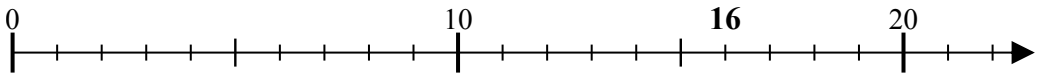

11) 8:4=

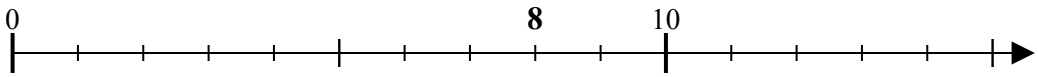

Câu trả lời

1. _____
2. _____
3. _____
4. _____
5. _____
6. _____
7. _____
8. _____
9. _____
10. _____
11. _____

1-10	91	82	73	64	55	45	36	27	18	9
11	0									

Dùng trục số để giải biểu thức.

1) 18:9=

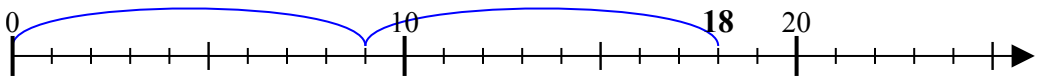

2) 15:5=

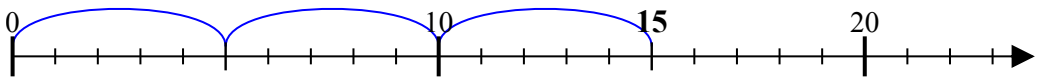

3) 8:2=

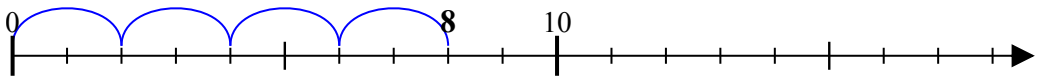

4) 16:4=

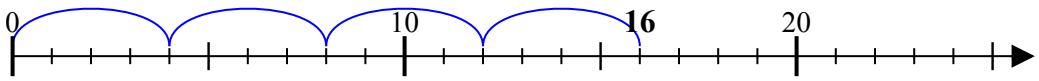

5) 40:10=

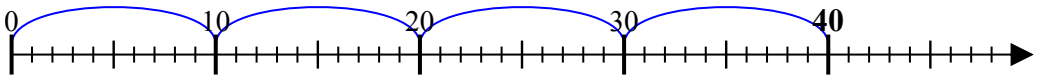

6) 4:2=

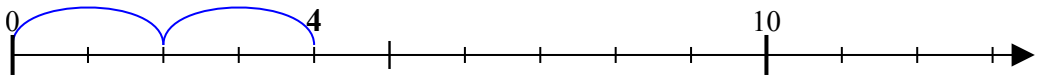

7) 45:9=

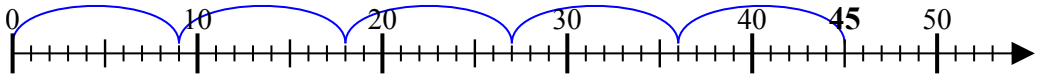

8) 15:3=

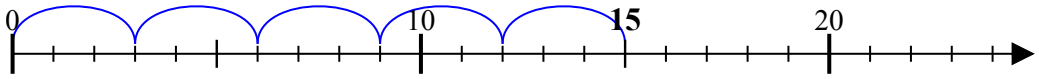

9) 28:7=

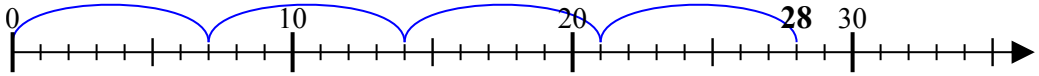

10) 16:8=

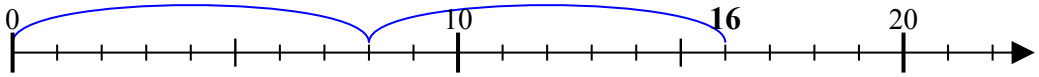

11) 8:4=

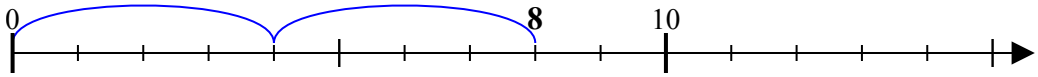

Câu trả lời

1. **2**
2. **3**
3. **4**
4. **4**
5. **4**
6. **2**
7. **5**
8. **5**
9. **4**
10. **2**
11. **2**

1-10	91	82	73	64	55	45	36	27	18	9
11	0									