Phép chia với trục số

Họ và Tên:

Dùng trục số để giải biểu thức.

1) 6:2=

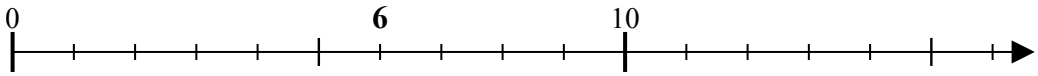

2) 18:9=

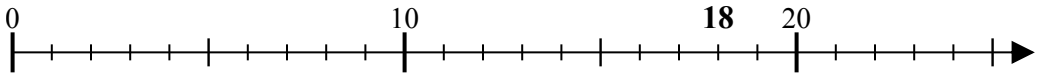

3) 28:7=

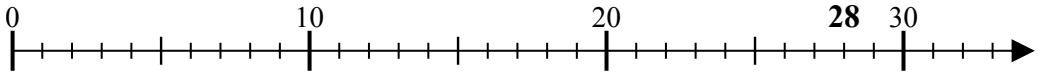

4) 45:9=

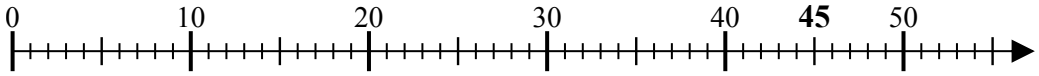

5) 8:4=

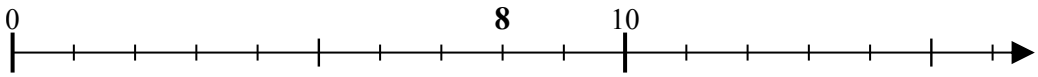

6) 30:10=

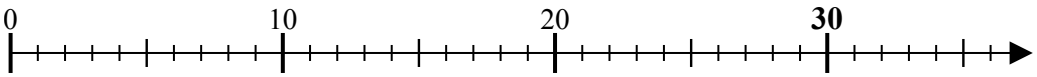

7) 14:7=

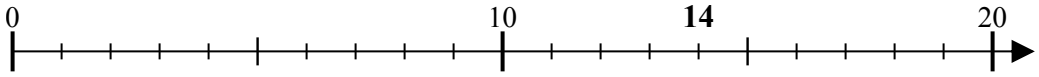

8) 16:4=

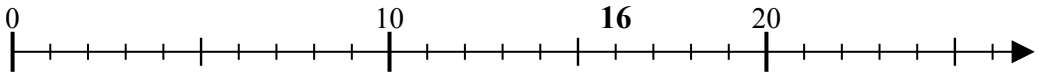

9) 15:3=

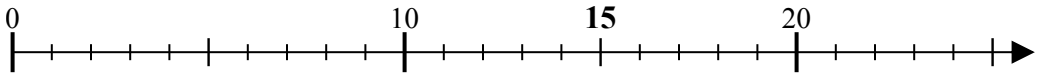

10) 12:6=

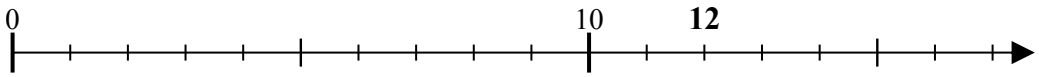

11) 25:5=

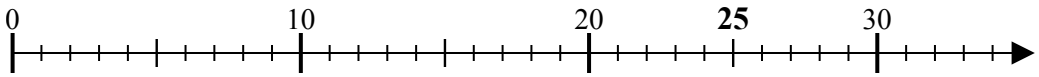

Câu trả lời

1. _____
2. _____
3. _____
4. _____
5. _____
6. _____
7. _____
8. _____
9. _____
10. _____
11. _____

1-10	91	82	73	64	55	45	36	27	18	9
11	0									

Dùng trục số để giải biểu thức.

1) 6:2=

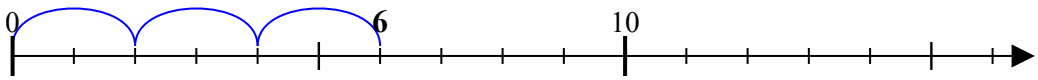

2) 18:9=

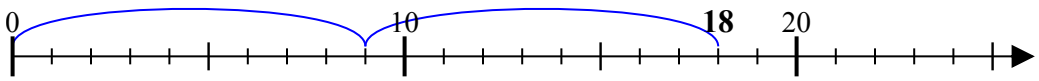

3) 28:7=

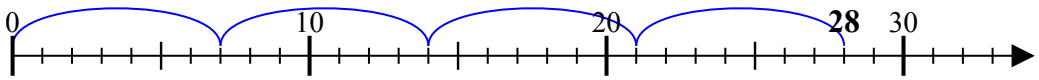

4) 45:9=

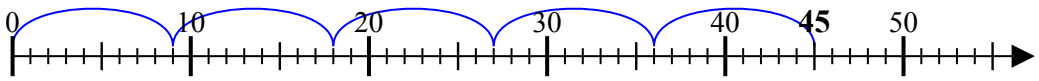

5) 8:4=

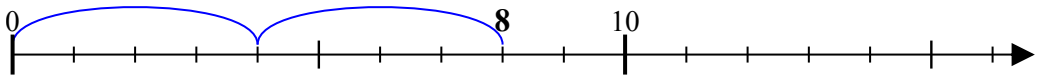

6) 30:10=

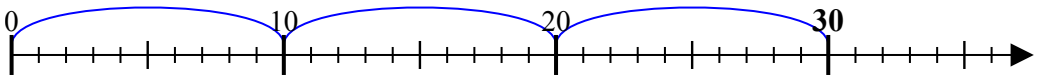

7) 14:7=

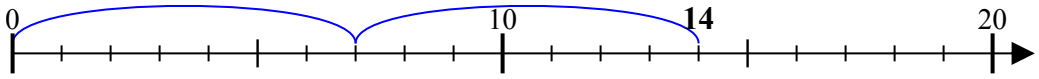

8) 16:4=

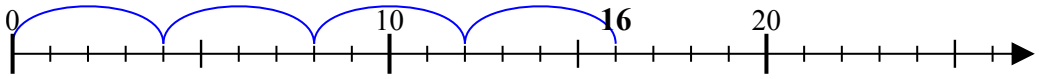

9) 15:3=

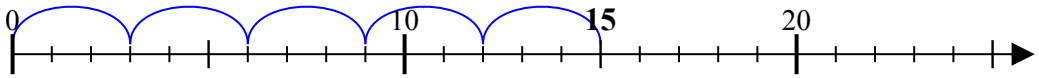

10) 12:6=

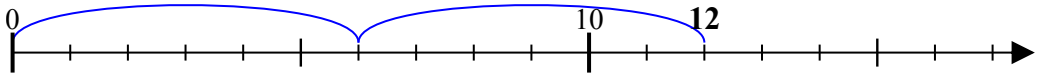

11) 25:5=

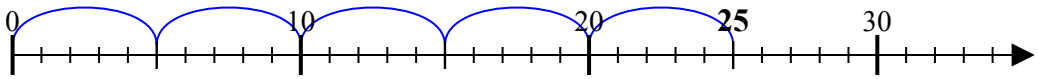

Câu trả lời

1. 3
2. 2
3. 4
4. 5
5. 2
6. 3
7. 2
8. 4
9. 5
10. 2
11. 5

1-10	91	82	73	64	55	45	36	27	18	9
11	0									