Phép chia với trục số

Họ và Tên:

Dùng trục số để giải biểu thức.

1) 24:6=

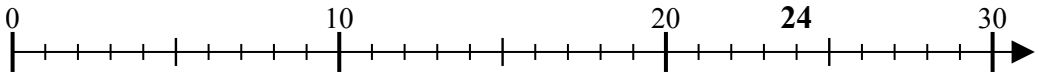

2) 16:8=

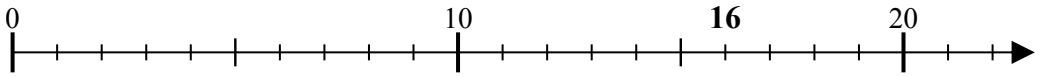

3) 10:2=

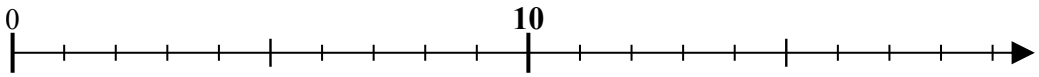

4) 40:8=

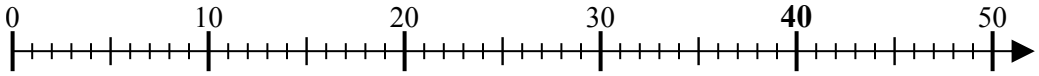

5) 6:2=

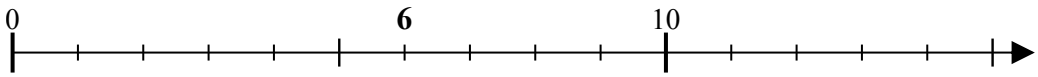

6) 40:10=

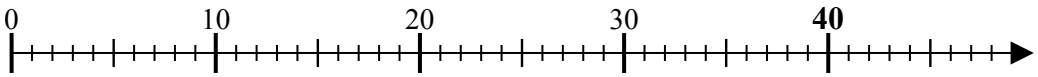

7) 15:3=

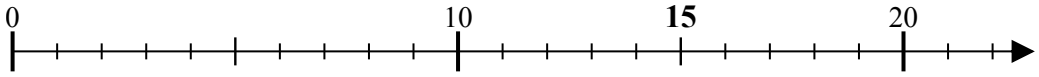

8) 18:9=

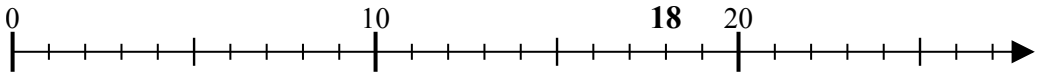

9) 27:9=

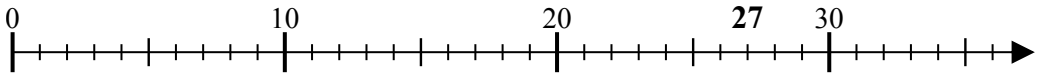

10) 36:9=

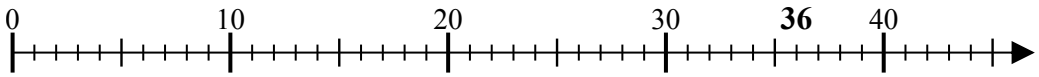

11) 8:4=

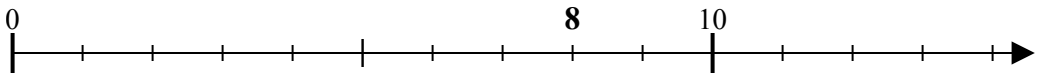

Câu trả lời

1. _____
2. _____
3. _____
4. _____
5. _____
6. _____
7. _____
8. _____
9. _____
10. _____
11. _____

1-10	91	82	73	64	55	45	36	27	18	9
11	0									

Dùng trục số để giải biểu thức.

1) 24:6=

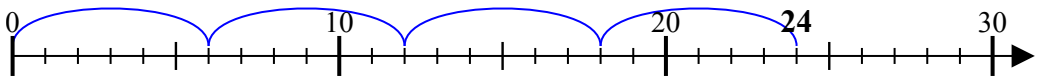

2) 16:8=

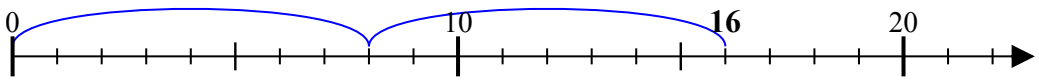

3) 10:2=

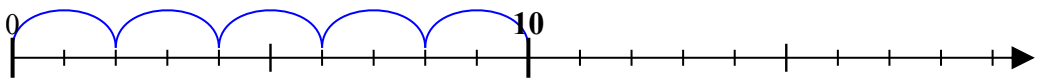

4) 40:8=

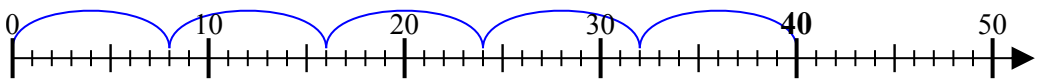

5) 6:2=

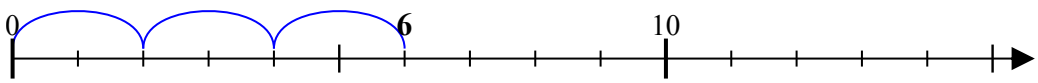

6) 40:10=

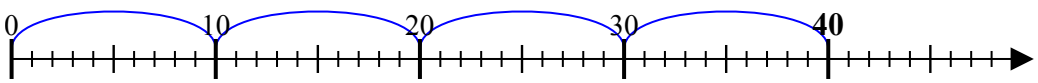

7) 15:3=

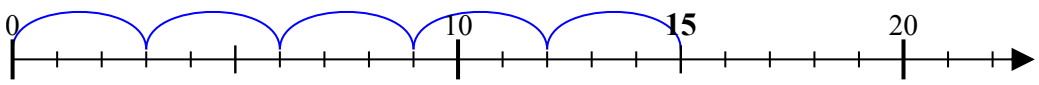

8) 18:9=

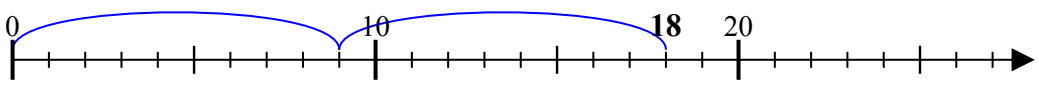

9) 27:9=

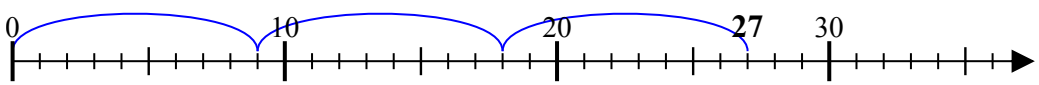

10) 36:9=

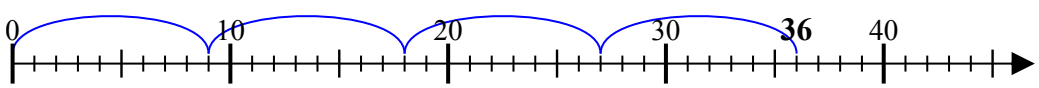

11) 8:4=

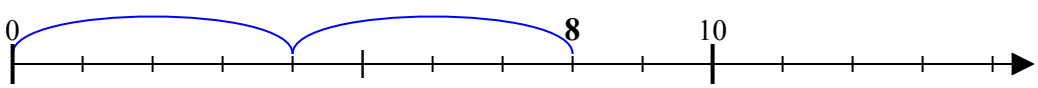

Câu trả lời

1. 4
2. 2
3. 5
4. 5
5. 3
6. 4
7. 5
8. 2
9. 3
10. 4
11. 2

1-10	91	82	73	64	55	45	36	27	18	9
11	0									