Dùng trục số để giải biểu thức.

1) 12:6=

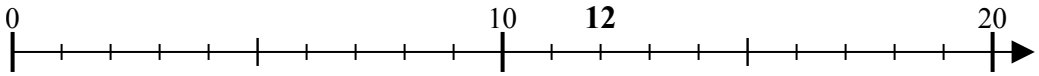

2) 50:10=

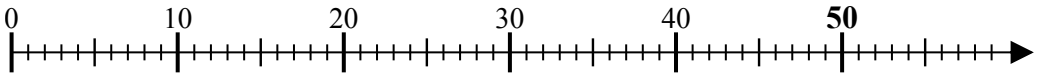

3) 6:2=

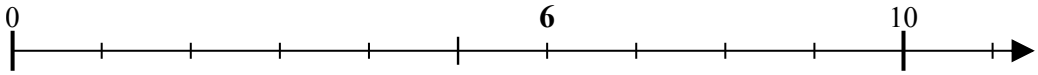

4) 10:5=

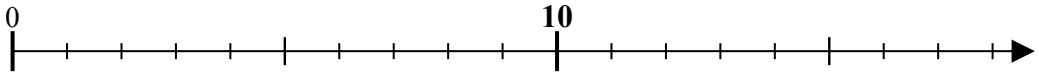

5) 16:8=

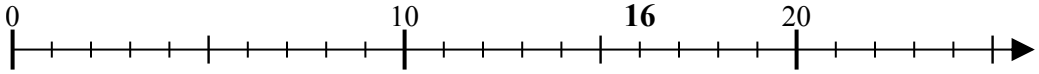

6) 8:2=

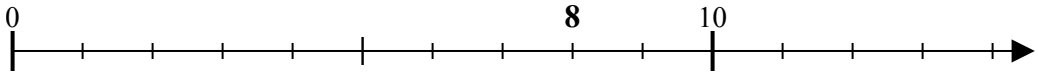

7) 35:7=

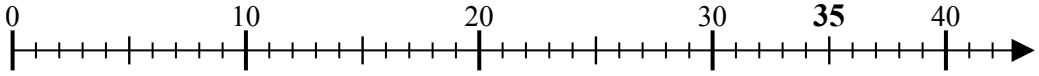

8) 40:10=

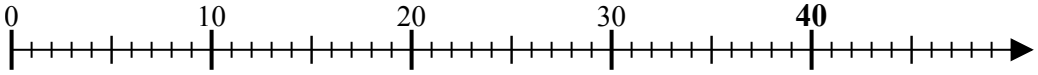

9) 18:6=

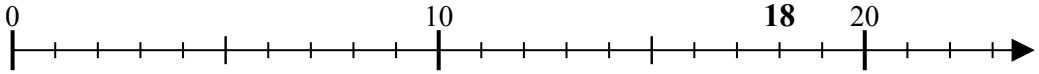

10) 25:5=

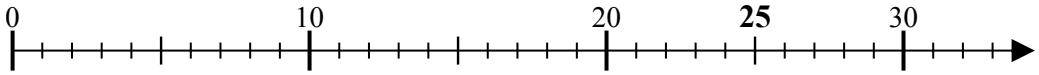

11) 30:6=

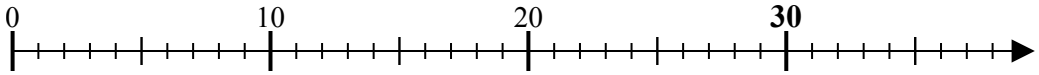

Câu trả lời

1. _____
2. _____
3. _____
4. _____
5. _____
6. _____
7. _____
8. _____
9. _____
10. _____
11. _____

1-10	91	82	73	64	55	45	36	27	18	9
11	0									

Dùng trục số để giải biểu thức.

1) 12:6=

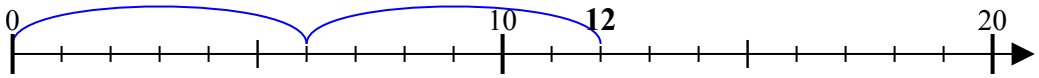

2) 50:10=

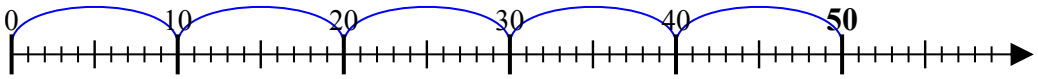

3) 6:2=

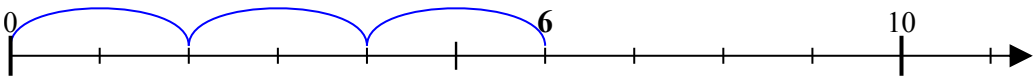

4) 10:5=

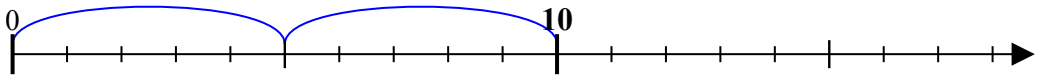

5) 16:8=

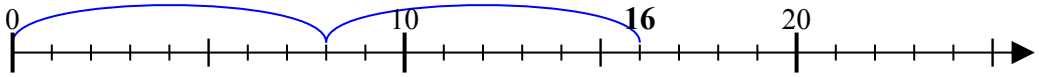

6) 8:2=

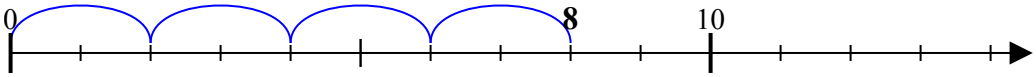

7) 35:7=

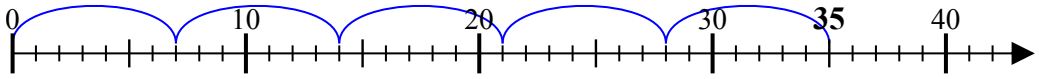

8) 40:10=

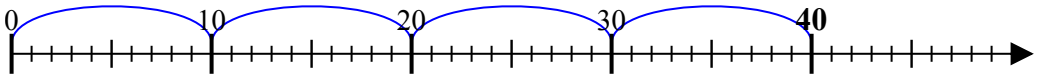

9) 18:6=

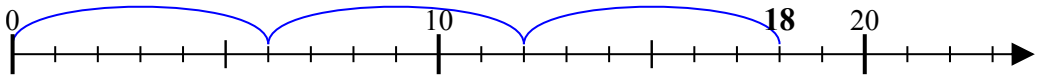

10) 25:5=

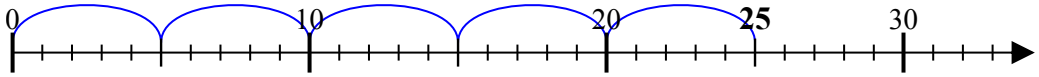

11) 30:6=

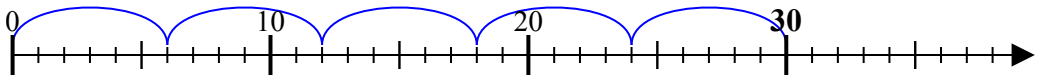

Câu trả lời

1. **2**
2. **5**
3. **3**
4. **2**
5. **2**
6. **4**
7. **5**
8. **4**
9. **3**
10. **5**
11. **5**

1-10	91	82	73	64	55	45	36	27	18	9
11	0									