Phép chia với trục số

Họ và Tên:

Dùng trục số để giải biểu thức.

1) 9:3=

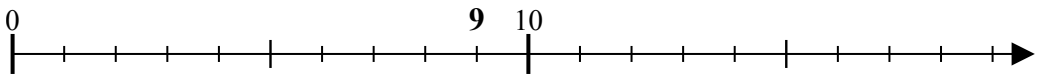

2) 10:5=

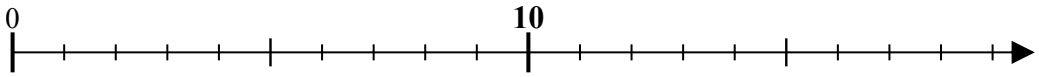

3) 32:8=

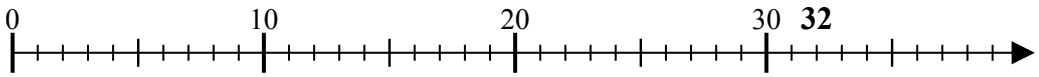

4) 8:2=

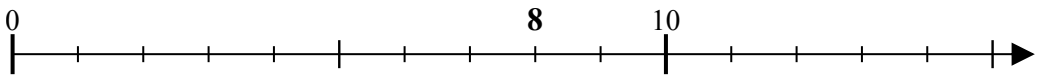

5) 24:6=

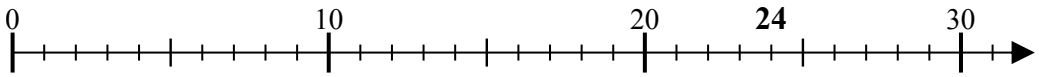

6) 8:4=

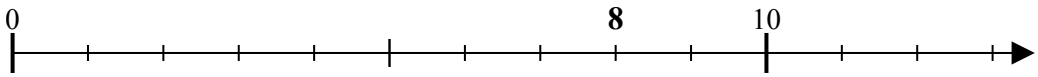

7) 4:2=

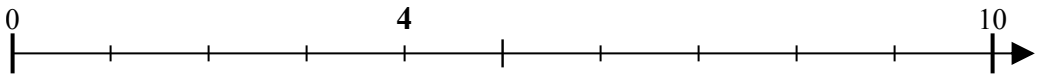

8) 30:6=

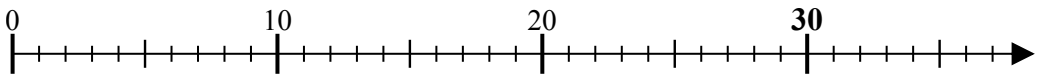

9) 20:4=

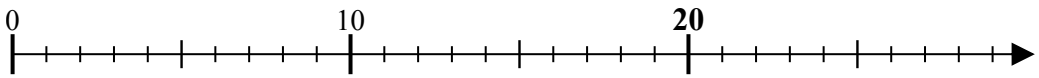

10) 12:4=

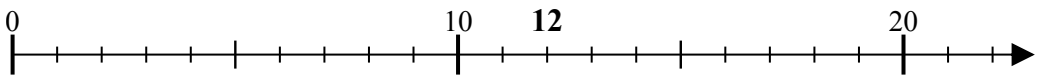

11) 50:10=

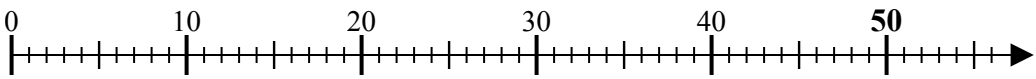

Câu trả lời

1. _____
2. _____
3. _____
4. _____
5. _____
6. _____
7. _____
8. _____
9. _____
10. _____
11. _____

1-10	91	82	73	64	55	45	36	27	18	9
11	0									

Phép chia với trục số

Họ và Tên: **Lời giải**

Dùng trục số để giải biểu thức.

1) 9:3=

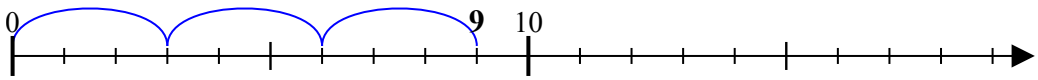

2) 10:5=

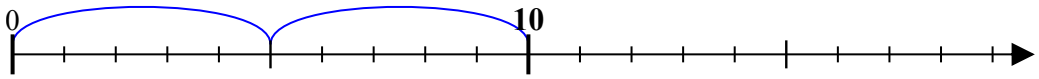

3) 32:8=

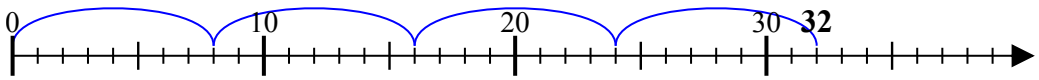

4) 8:2=

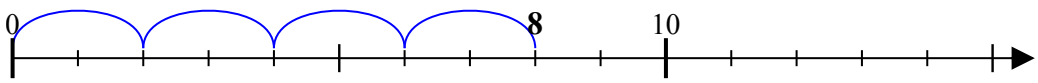

5) 24:6=

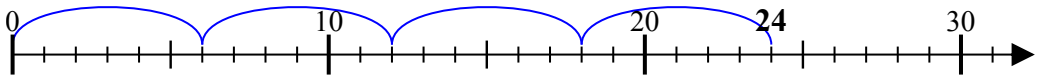

6) 8:4=

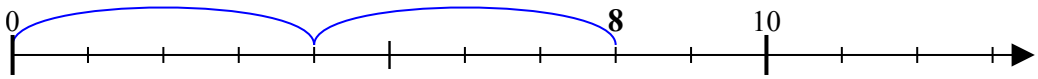

7) 4:2=

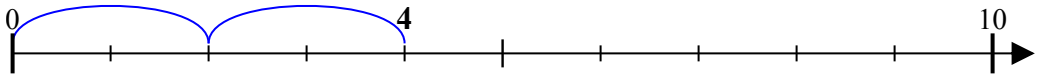

8) 30:6=

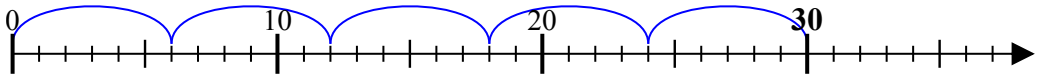

9) 20:4=

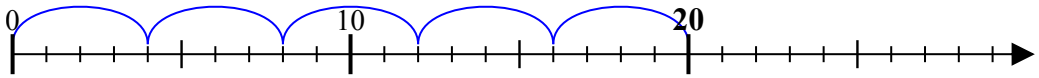

10) 12:4=

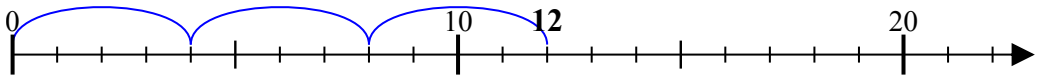

11) 50:10=

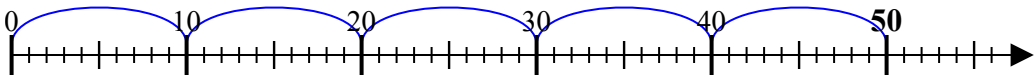

Câu trả lời

1. 3
2. 2
3. 4
4. 4
5. 4
6. 2
7. 2
8. 5
9. 5
10. 3
11. 5

1-10	91	82	73	64	55	45	36	27	18	9
11	0									