Phép chia với trục số

Họ và Tên:

Dùng trục số để giải biểu thức.

1) 30:10=

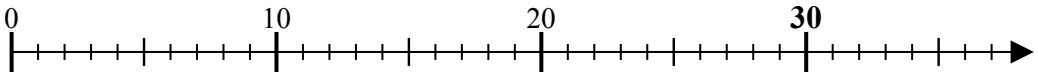

2) 28:7=

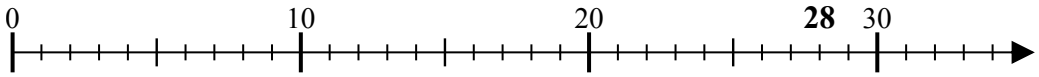

3) 6:3=

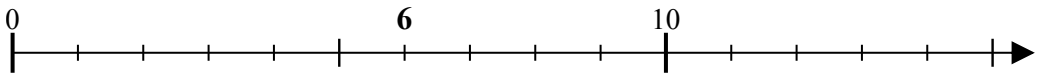

4) 32:8=

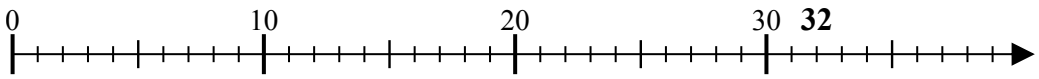

5) 15:3=

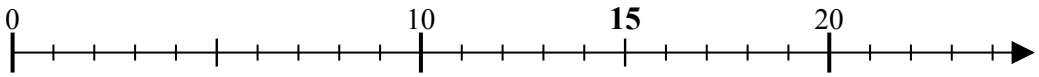

6) 10:5=

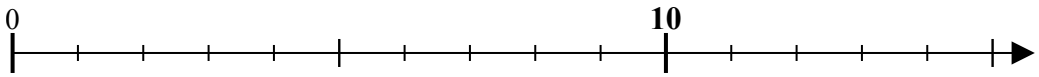

7) 18:6=

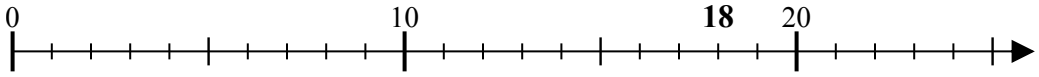

8) 20:10=

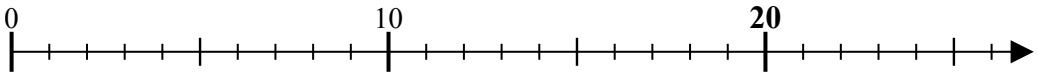

9) 36:9=

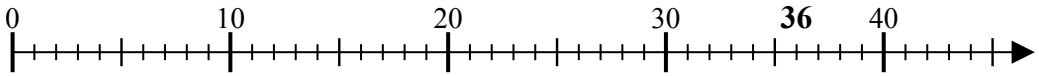

10) 20:4=

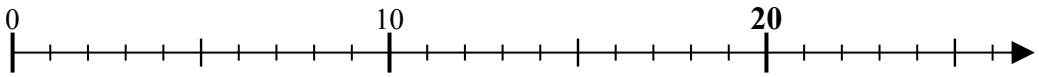

11) 9:3=

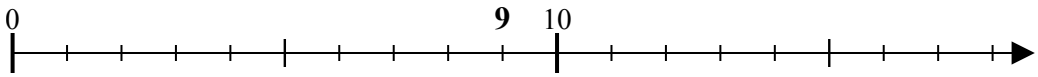

Câu trả lời

1. _____
2. _____
3. _____
4. _____
5. _____
6. _____
7. _____
8. _____
9. _____
10. _____
11. _____

1-10	91	82	73	64	55	45	36	27	18	9
11	0									

Dùng trục số để giải biểu thức.

1) 30:10=

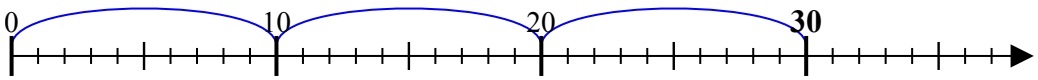

2) 28:7=

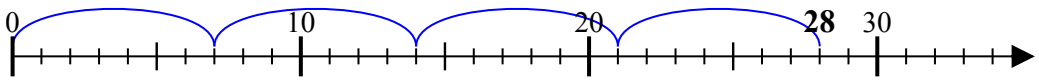

3) 6:3=

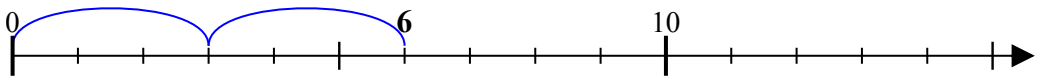

4) 32:8=

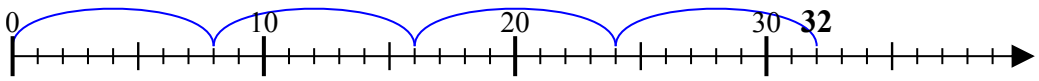

5) 15:3=

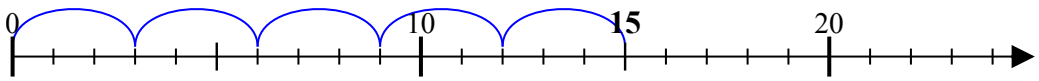

6) 10:5=

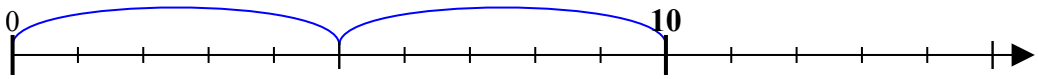

7) 18:6=

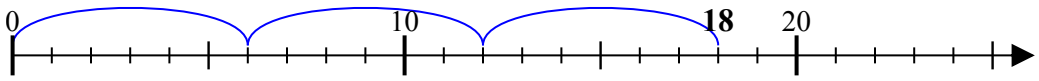

8) 20:10=

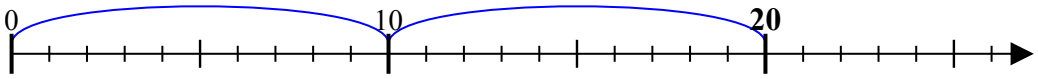

9) 36:9=

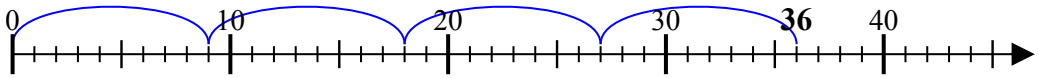

10) 20:4=

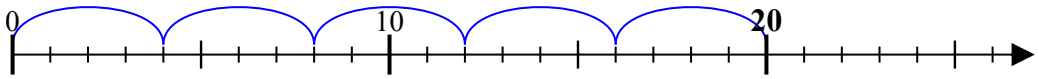

11) 9:3=

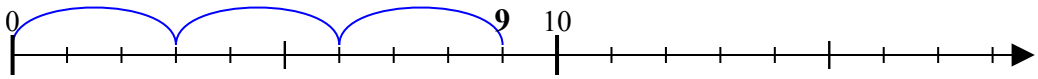

Câu trả lời

1. 3
2. 4
3. 2
4. 4
5. 5
6. 2
7. 3
8. 2
9. 4
10. 5
11. 3

1-10	91	82	73	64	55	45	36	27	18	9
11	0									