Phép chia với trục số

Họ và Tên:

Dùng trục số để giải biểu thức.

1) 18:9=

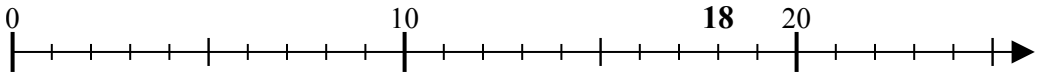

2) 15:5=

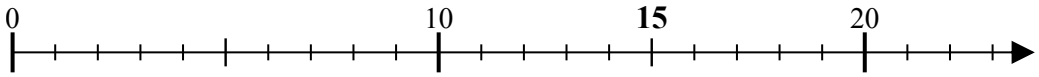

3) 8:2=

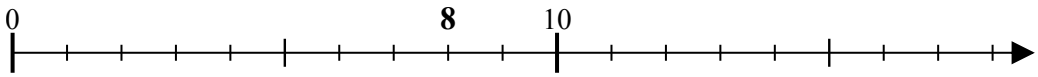

4) 16:4=

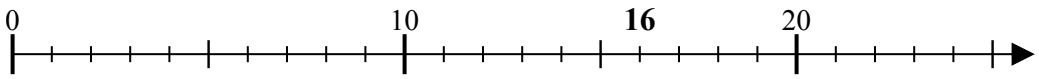

5) 40:10=

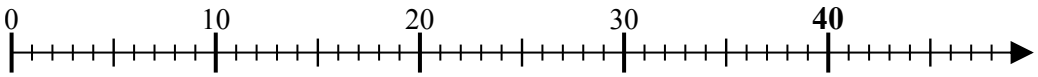

6) 4:2=

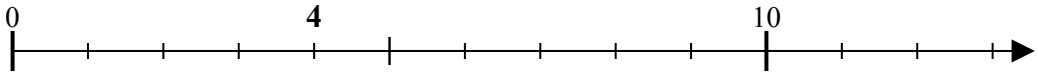

7) 45:9=

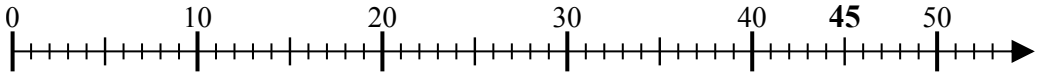

8) 15:3=

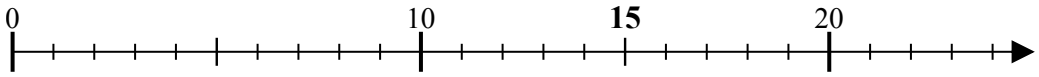

9) 28:7=

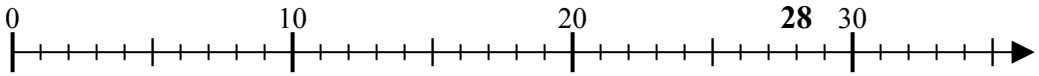

10) 16:8=

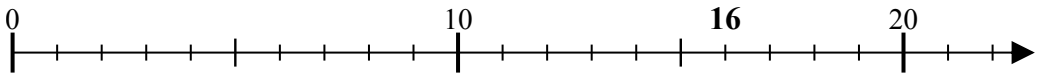

11) 8:4=

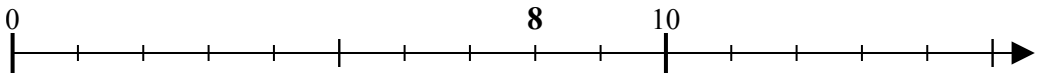

Câu trả lời

1. _____
2. _____
3. _____
4. _____
5. _____
6. _____
7. _____
8. _____
9. _____
10. _____
11. _____

1-10	91	82	73	64	55	45	36	27	18	9
11	0									

Dùng trục số để giải biểu thức.

1) 18:9=

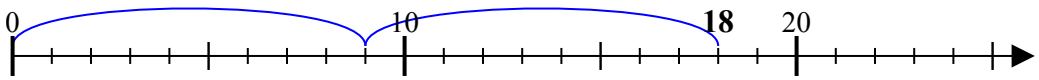

2) 15:5=

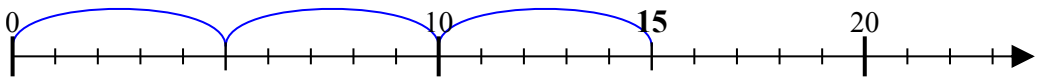

3) 8:2=

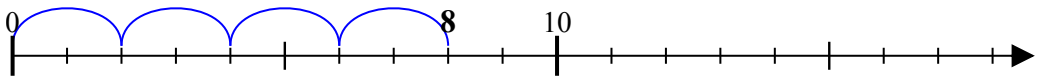

4) 16:4=

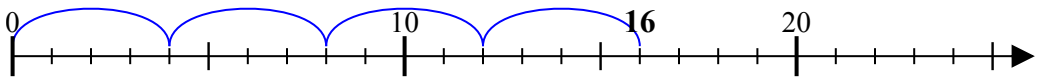

5) 40:10=

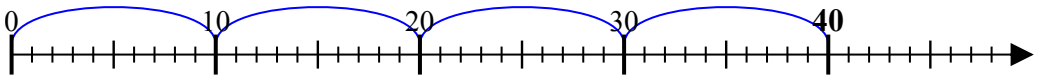

6) 4:2=

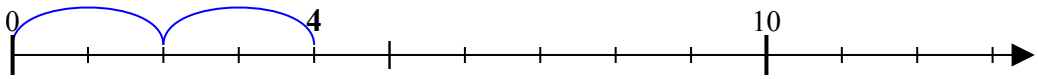

7) 45:9=

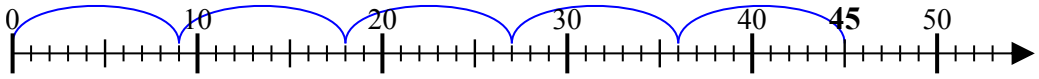

8) 15:3=

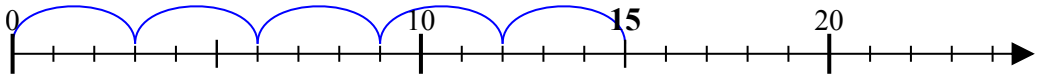

9) 28:7=

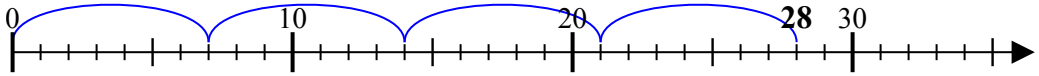

10) 16:8=

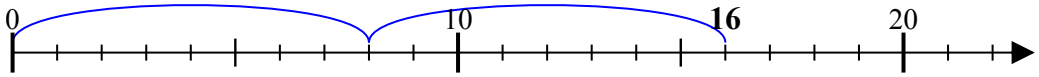

11) 8:4=

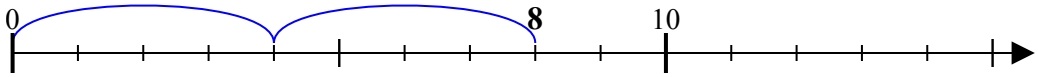

Câu trả lời

1. **2**
2. **3**
3. **4**
4. **4**
5. **4**
6. **2**
7. **5**
8. **5**
9. **4**
10. **2**
11. **2**

1-10	91	82	73	64	55	45	36	27	18	9
11	0									