Phép chia với trục số

Họ và Tên:

Dùng trục số để giải biểu thức.

1) 9:3=

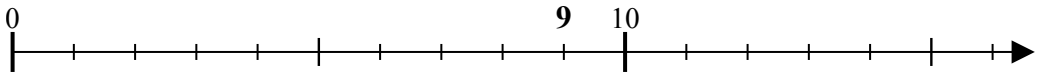

2) 6:2=

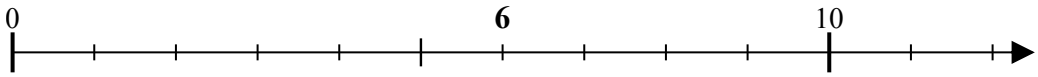

3) 12:4=

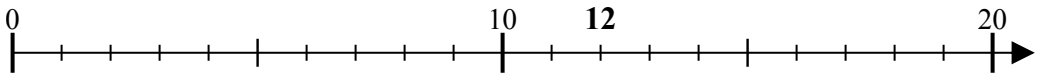

4) 15:5=

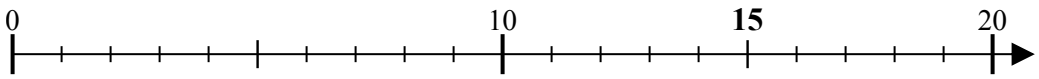

5) 28:7=

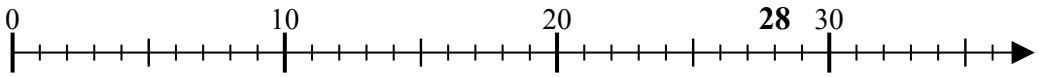

6) 40:10=

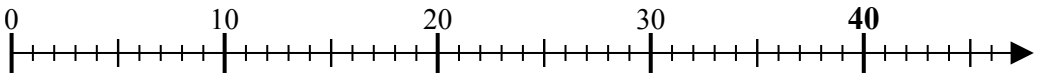

7) 24:6=

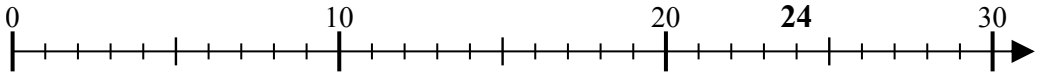

8) 30:10=

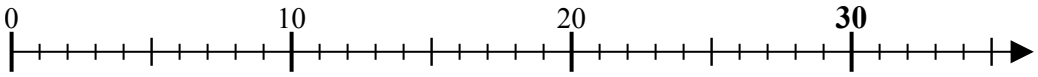

9) 30:6=

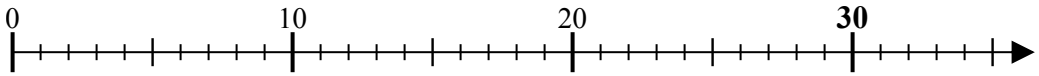

10) 12:3=

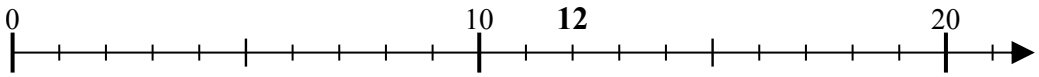

11) 18:6=

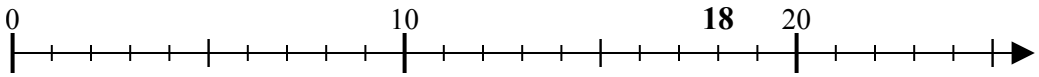

Câu trả lời

1. _____
2. _____
3. _____
4. _____
5. _____
6. _____
7. _____
8. _____
9. _____
10. _____
11. _____

1-10	91	82	73	64	55	45	36	27	18	9
11	0									

Phép chia với trục số

Họ và Tên: **Lời giải**

Dùng trục số để giải biểu thức.

1) 9:3=

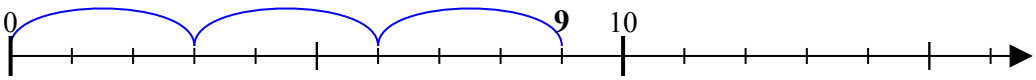

2) 6:2=

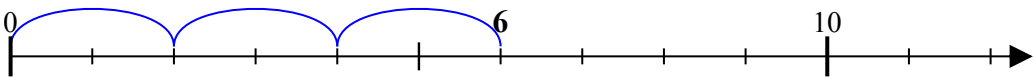

3) 12:4=

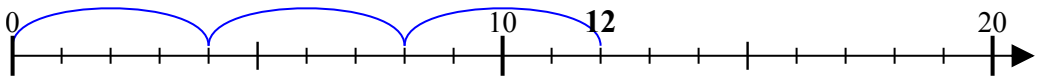

4) 15:5=

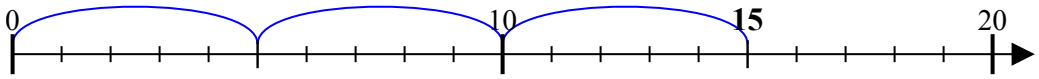

5) 28:7=

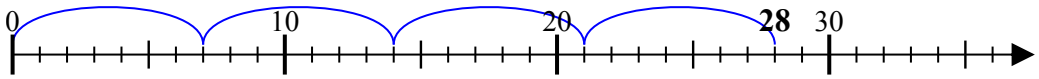

6) 40:10=

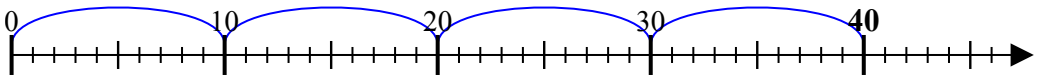

7) 24:6=

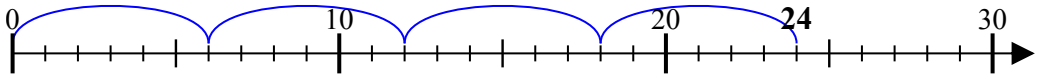

8) 30:10=

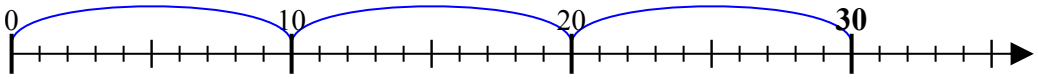

9) 30:6=

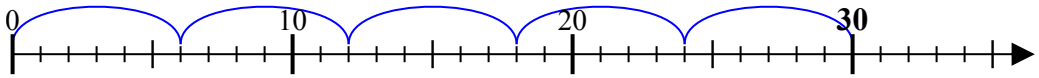

10) 12:3=

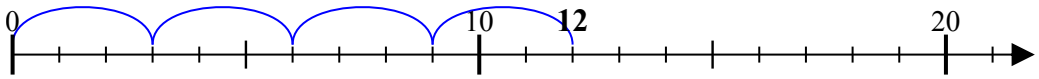

11) 18:6=

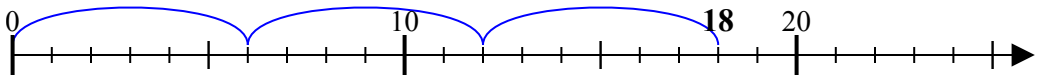

Câu trả lời

1. 3
2. 3
3. 3
4. 3
5. 4
6. 4
7. 4
8. 3
9. 5
10. 4
11. 3

1-10	91	82	73	64	55	45	36	27	18	9
11	0									